Lecture d'une Horloge Analogique (F)

Nom: _____ Date: _____

Lisez chaque heure et écrivez-la dans l'espace sous l'horloge.

1.

_____

2.



_____

3.



_____

4.



_____

Lecture d'une Horloge Analogique (F) Solutions

Nom: _____ Date: _____

Lisez chaque heure et écrivez-la dans l'espace sous l'horloge.

1.



15h25m15s

2.



05h48m00s

3.



19h34m30s

4.



10h29m45s