Lecture d'une Horloge Analogique (D)

Nom: _____ Date: _____

Lisez chaque heure et écrivez-la dans l'espace sous l'horloge.

1.



Minuit Midi

_____

2.



Midi Minuit

_____

3.



Midi Minuit

_____

4.

Minuit Midi

_____

Lecture d'une Horloge Analogique (D) Solutions

Nom: _____ Date: _____

Lisez chaque heure et écrivez-la dans l'espace sous l'horloge.

1.



00h44m55s

2.

17h45m30s

3.



18h18m15s

4.



10h26m05s