Lecture d'une Horloge Analogique (E)

Nom: _____ Date: _____

Lisez chaque heure et écrivez-la dans l'espace sous l'horloge.

1.



_____

2.



_____

3.



_____

4.



_____

Lecture d'une Horloge Analogique (E) Solutions

Nom: _____ Date: _____

Lisez chaque heure et écrivez-la dans l'espace sous l'horloge.

1.



20h00m

2.



05h00m

3.



11h00m

4.



15h00m