Soustraction de Nombres - Droite Graduée (F)

Utlisez la droite graduée pour calculer chaque différence.

1. $70 - 45 =$ ____

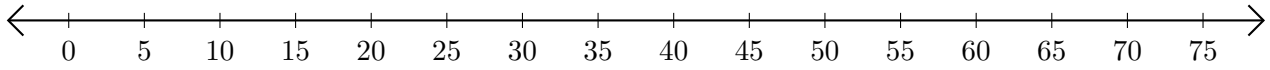

2. $30 - 5 =$ ____

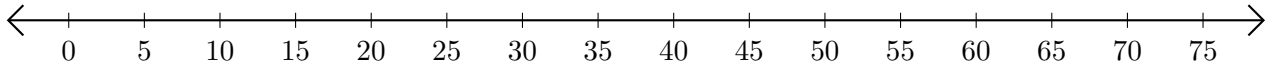

3. $70 - 40 =$ ____

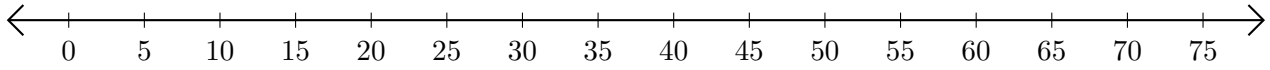

4. $55 - 30 =$ ____

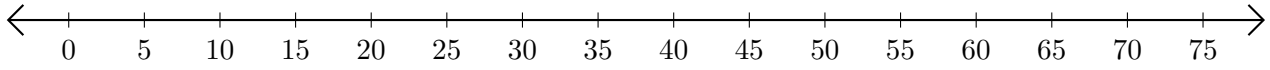
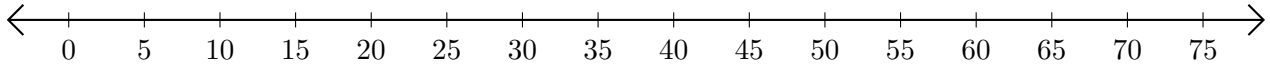
5. $75 - 65 =$ ____