Soustraction de Nombres - Droite Graduée (D)

Utlisez la droite graduée pour calculer chaque différence.

1. $65 - 55 =$ ____

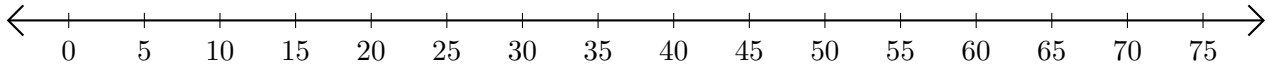

2. $70 - 5 =$ ____

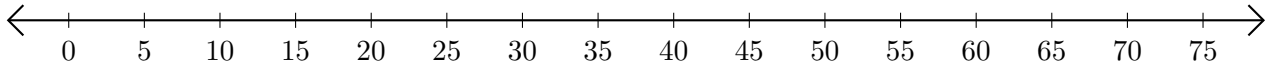

3. $65 - 30 =$ ____

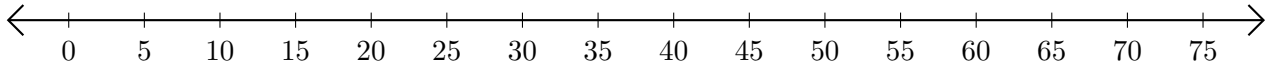

4. $75 - 65 =$ ____

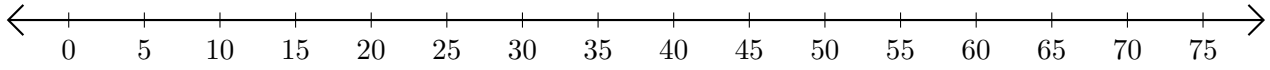
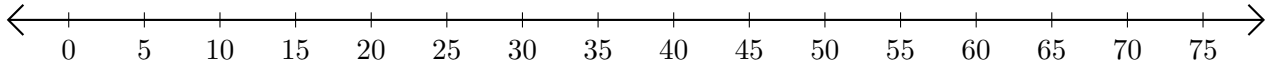
5. $50 - 45 =$ ___