Soustraction de Nombres - Droite Graduée (J)

Utlisez la droite graduée pour calculer chaque différence.

1. $45 - 20 =$ ____

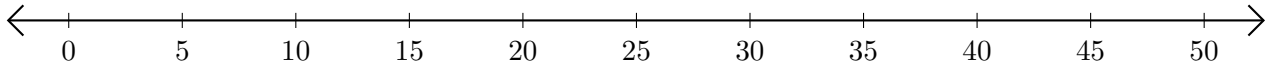

2. $45 - 30 =$ ____

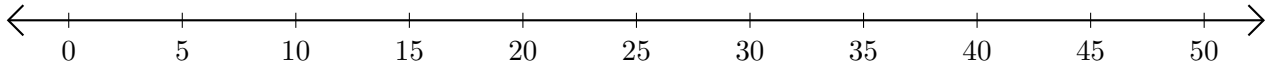

3. $45 - 35 =$ ____

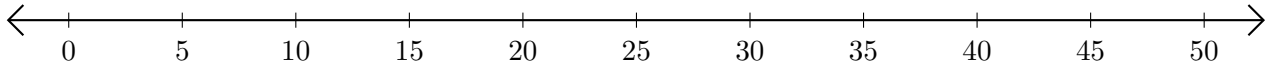

4. $25 - 10 =$ ____

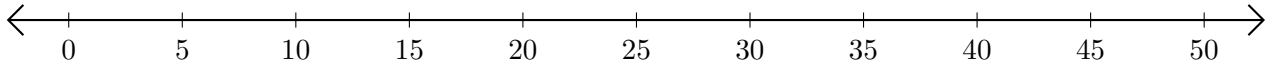

5. $50 - 45 =$ ___

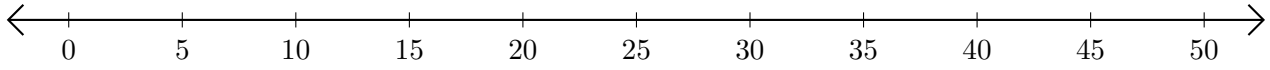

Soustraction de Nombres - Droite Graduée (J) Réponses

Utlisez la droite graduée pour calculer chaque différence.

1. $45 - 20 =$ 25

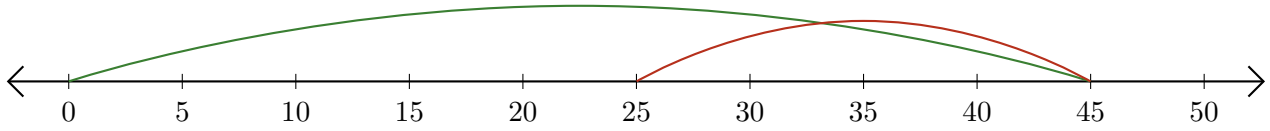

2. $45 - 30 =$ 15

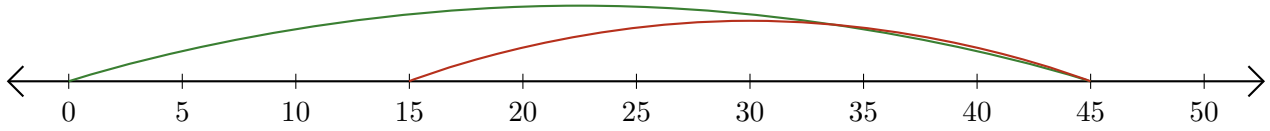

3. $45 - 35 =$ 10

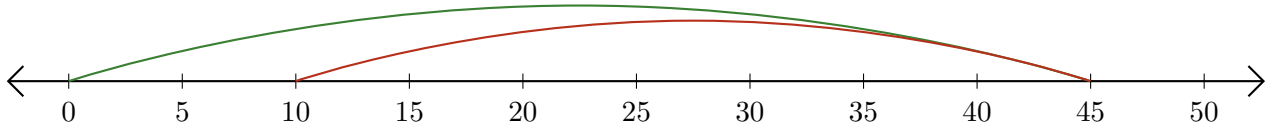

4. $25 - 10 =$ 15

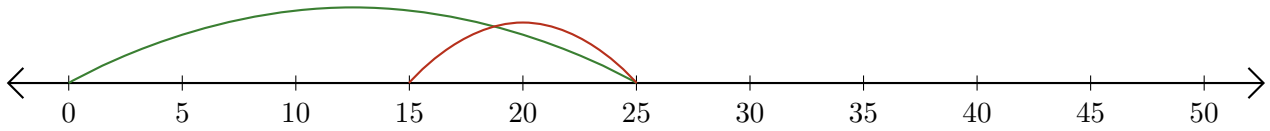
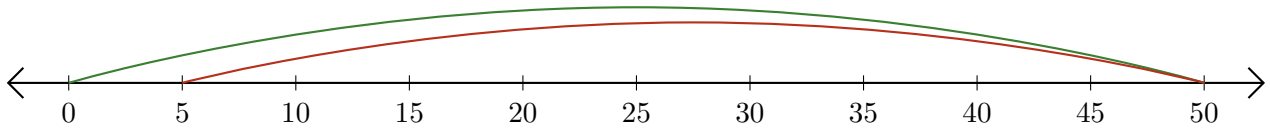
5. $50 - 45 =$ 5