Soustraction de Nombres - Droite Graduée (F)

Utlisez la droite graduée pour calculer chaque différence.

1. $45 - 15 =$ ____

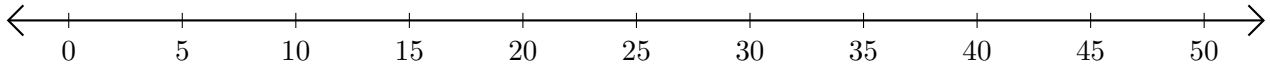

2. $35 - 30 =$ ___

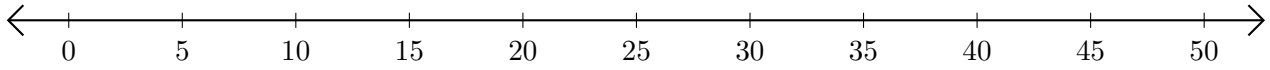

3. $40 - 10 =$ ____

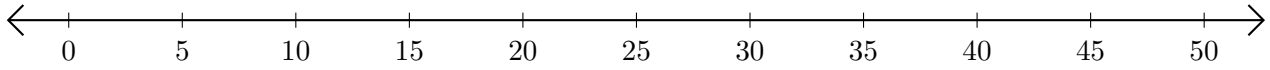

4. $50 - 20 =$ ____

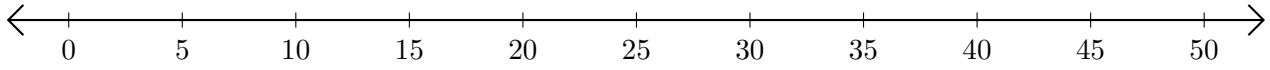

5. $50 - 25 =$ ____

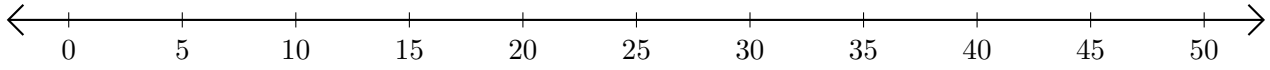

Soustraction de Nombres - Droite Graduée (F) Réponses

Utlisez la droite graduée pour calculer chaque différence.

1. $45 - 15 =$ 30

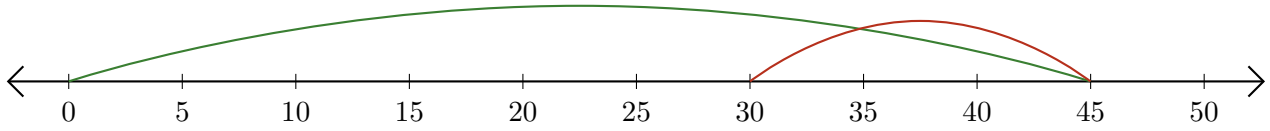

2. $35 - 30 =$ 5

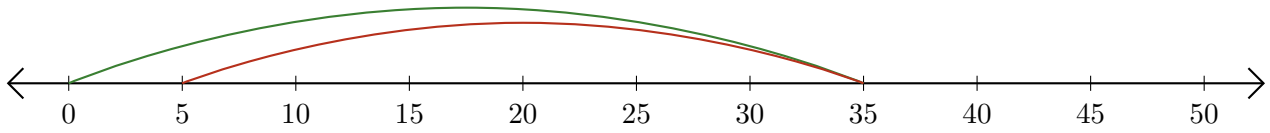

3. $40 - 10 =$ 30

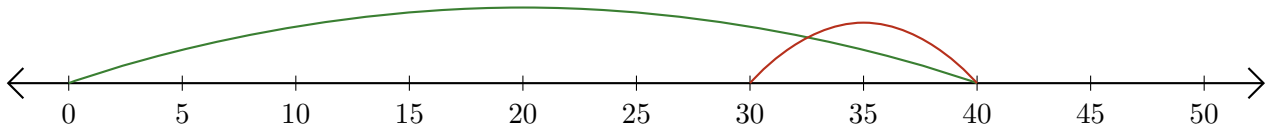

4. $50 - 20 =$ 30

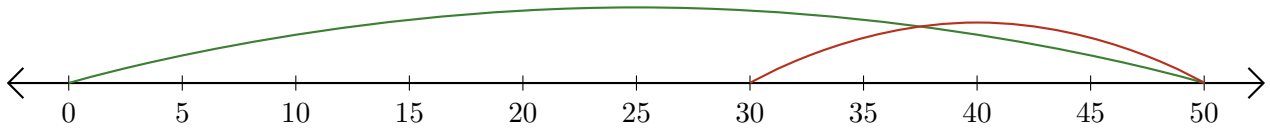
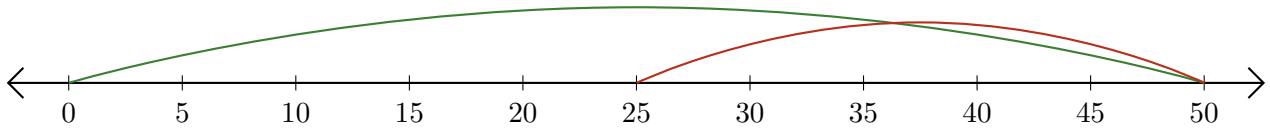
5. $50 - 25 =$ 25