Soustraction de Nombres - Droite Graduée (J)

Utlisez la droite graduée pour calculer chaque différence.

1. $20 - 18 =$ ___

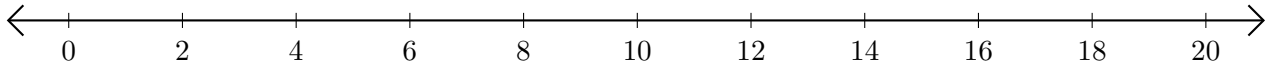

2. $12 - 10 =$ ___

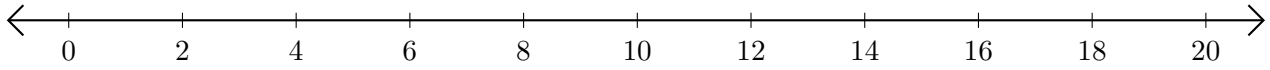

3. $20 - 12 =$ ___

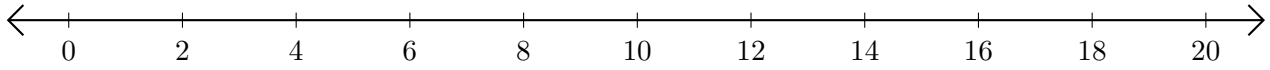

4. $16 - 6 =$ ____

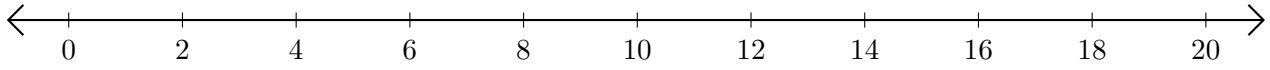

5. $4 - 2 =$ ___

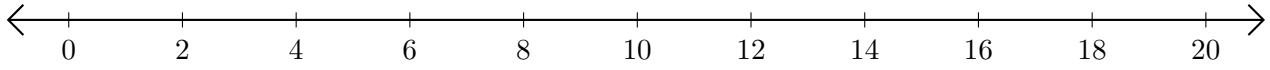

Soustraction de Nombres - Droite Graduée (J) Réponses

Utlisez la droite graduée pour calculer chaque différence.

1. $20 - 18 =$ 2

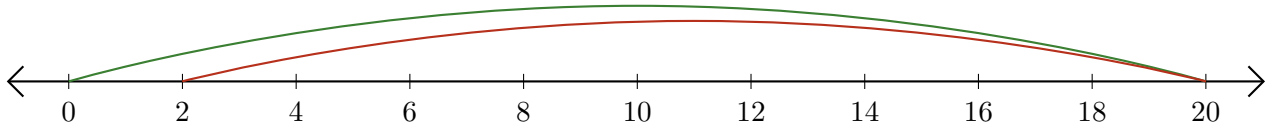

2. $12 - 10 =$ 2

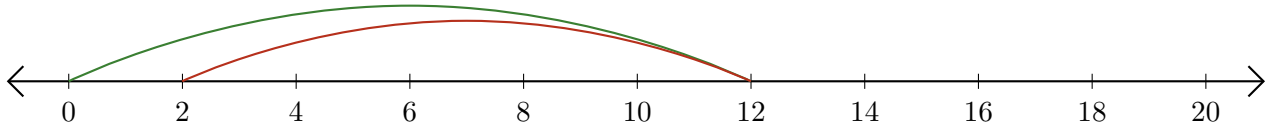

3. $20 - 12 =$ 8

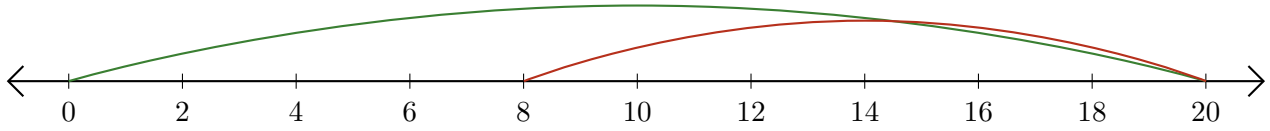

4. $16 - 6 =$ 10

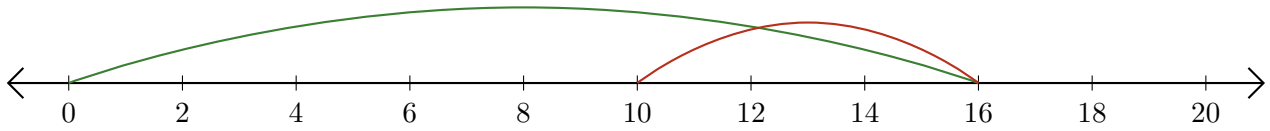
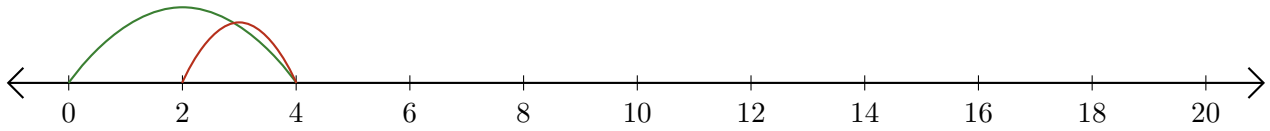
5. $4 - 2 =$ 2