Soustraction de Nombres - Droite Graduée (G)

Utlisez la droite graduée pour calculer chaque différence.

1. $16 - 2 =$ ____

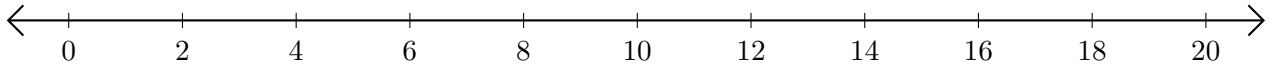

2. $20 - 16 =$ ___

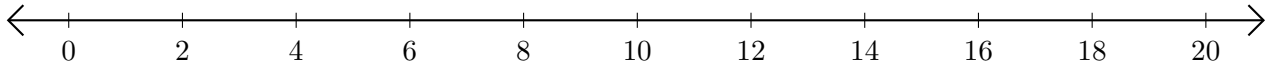

3. $16 - 8 =$ ___

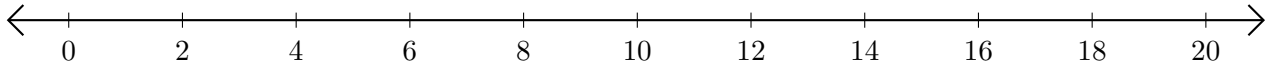

4. $14 - 12 =$ ___

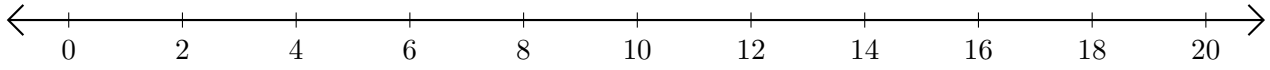

5. $16 - 14 =$ ___

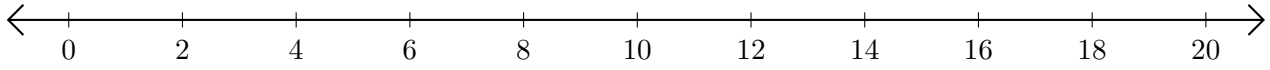

Soustraction de Nombres - Droite Graduée (G) Réponses

Utlisez la droite graduée pour calculer chaque différence.

1. $16 - 2 =$ 14

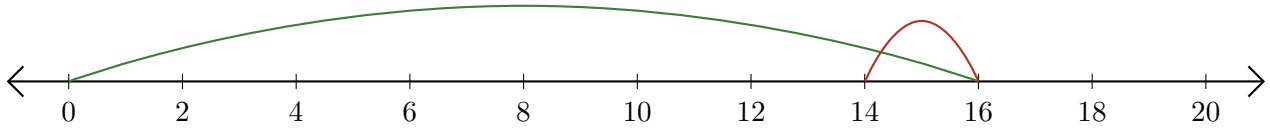

2. $20 - 16 =$ 4

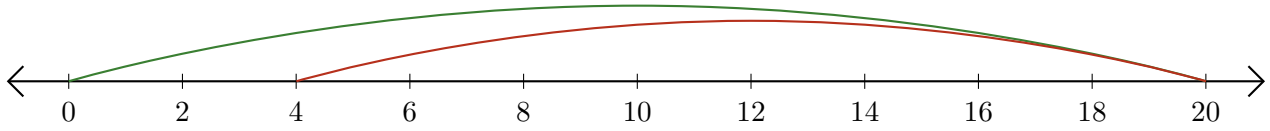

3. $16 - 8 =$ 8

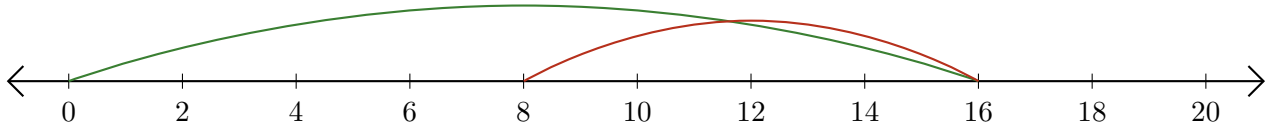

4. $14 - 12 =$ 2

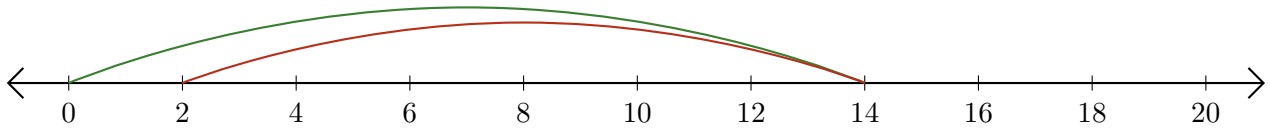
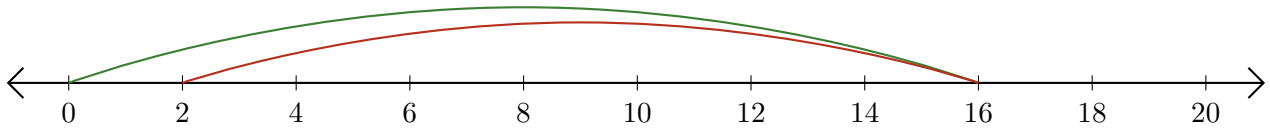
5. $16 - 14 =$ 2