Soustraction de Nombres - Droite Graduée (B)

Utlisez la droite graduée pour calculer chaque différence.

1. $20 - 18 =$ ___

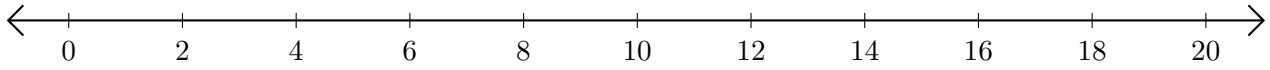

2. $20 - 10 =$ ____

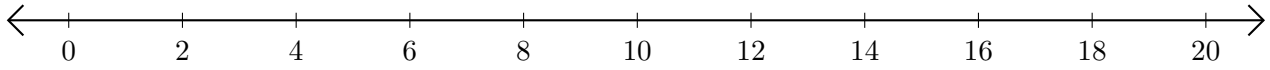

3. $18 - 12 =$ ___

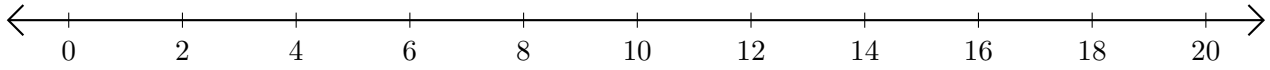

4. $20 - 16 =$ ___

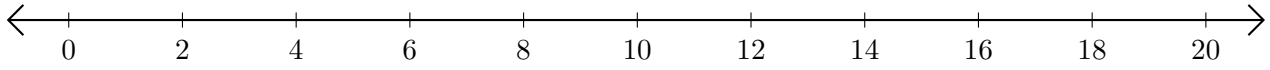

5. $18 - 2 =$ ____

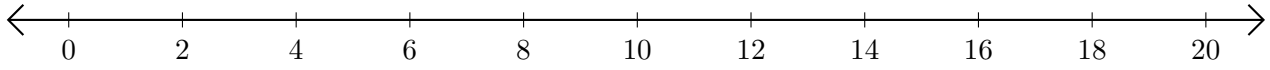

Soustraction de Nombres - Droite Graduée (B) Réponses

Utlisez la droite graduée pour calculer chaque différence.

1. $20 - 18 =$ 2

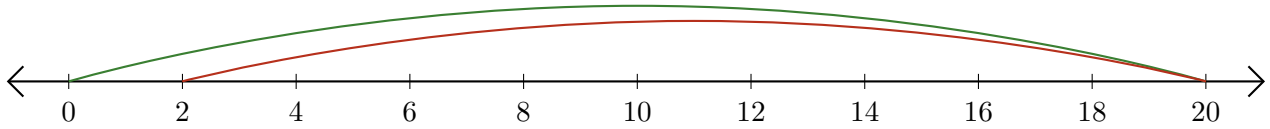

2. $20 - 10 =$ 10

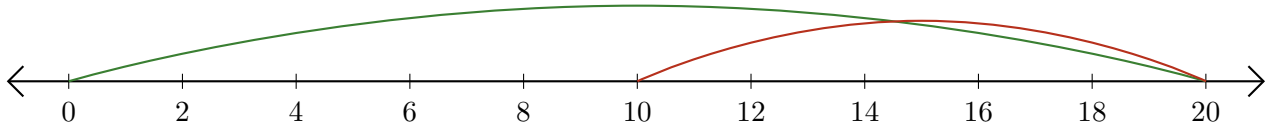

3. $18 - 12 =$ 6

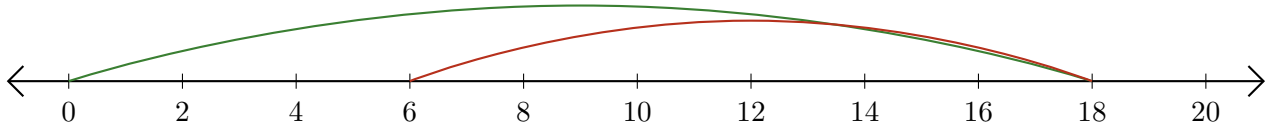

4. $20 - 16 =$ 4

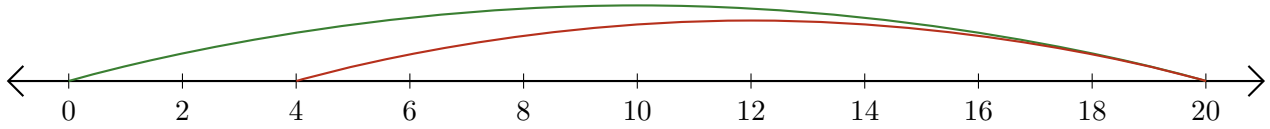
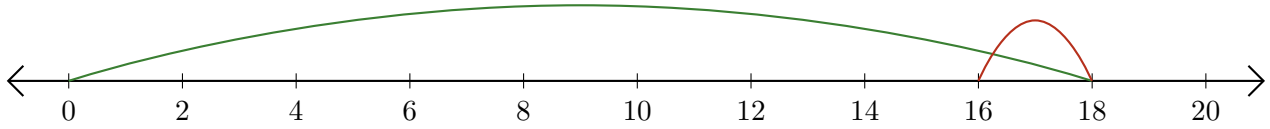
5. $18 - 2 =$ 16