Soustraction de Nombres - Droite Graduée (B)

Utlisez la droite graduée pour calculer chaque différence.

1. $13 - 11 =$ ___

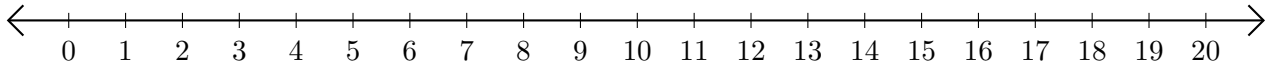

2. $20 - 14 =$ ___

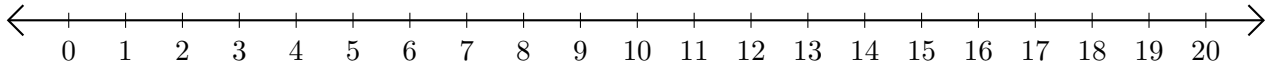

3. $20 - 19 =$ ___

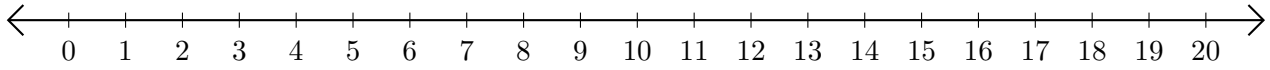

4. $17 - 10 =$ ___

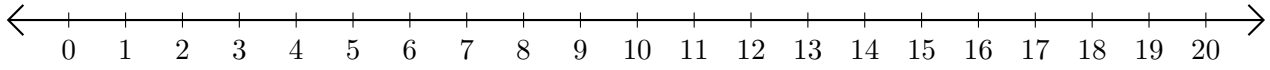

5. $12 - 6 =$ ___

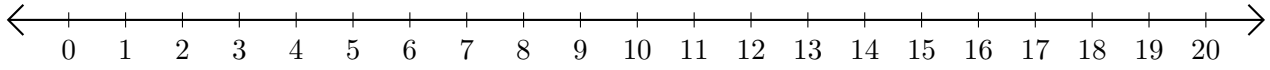

Soustraction de Nombres - Droite Graduée (B) Réponses

Utlisez la droite graduée pour calculer chaque différence.

1. $13 - 11 =$ 2

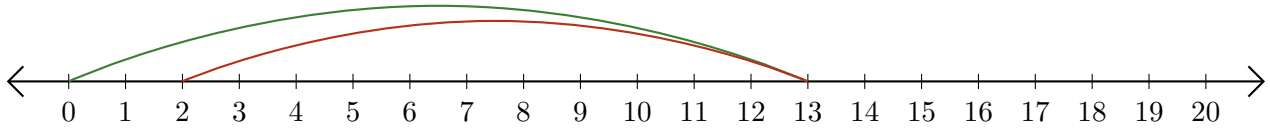

2. $20 - 14 =$ 6

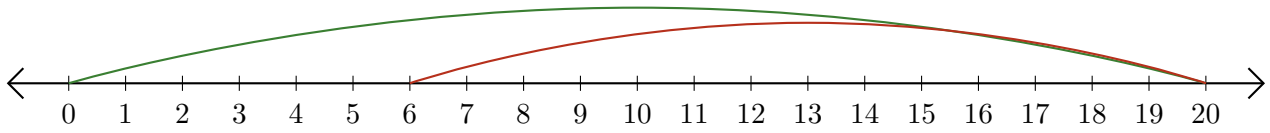

3. $20 - 19 =$ 1

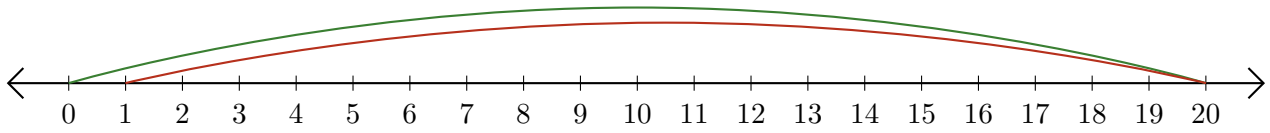

4. $17 - 10 =$ 7

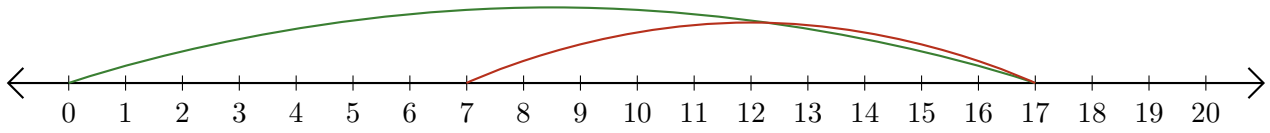
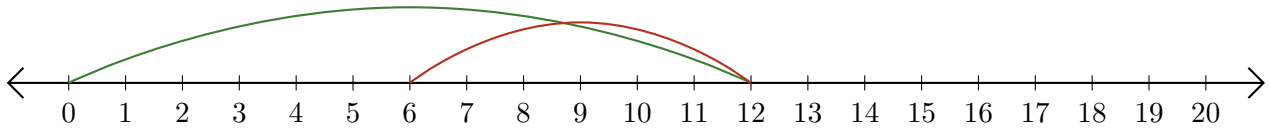
5. $12 - 6 =$ 6