Soustraction de Nombres - Droite Graduée (J)

Utlisez la droite graduée pour calculer chaque différence.

1. $9 - 8 =$ ___

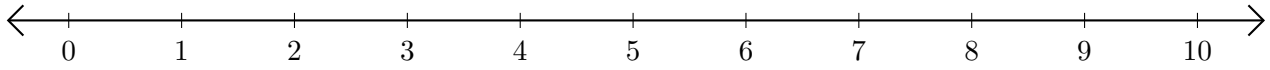

2. $8 - 6 =$ ___

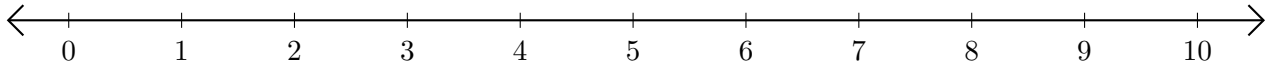

3. $6 - 4 =$ ___

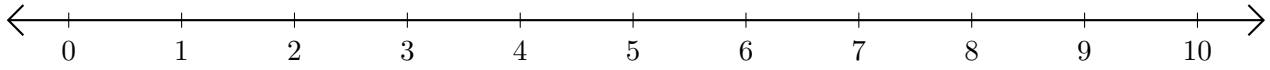

4. $9 - 7 =$ ___

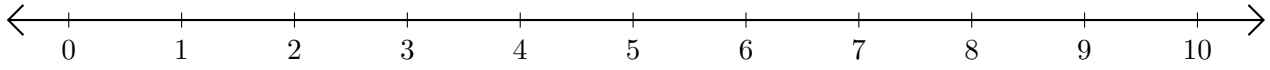
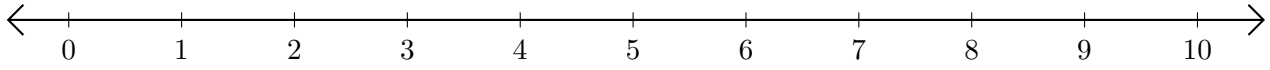
5. $8 - 2 =$ ___