Soustraction de Nombres - Droite Graduée (A)

Utlisez la droite graduée pour calculer chaque différence.

1. $7 - 5 =$ ___

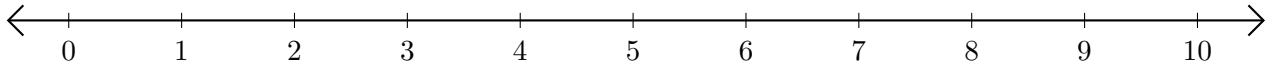

2. $10 - 8 =$ ___

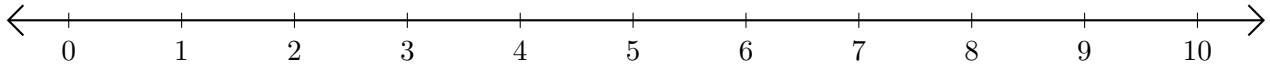

3. $10 - 9 =$ ___

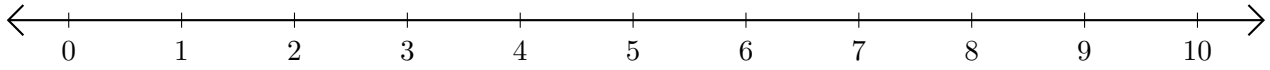

4. $9 - 4 =$ ___

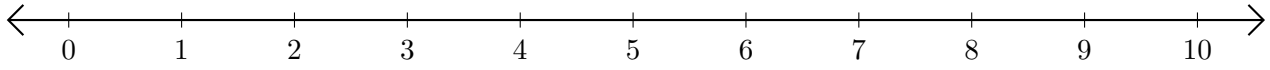
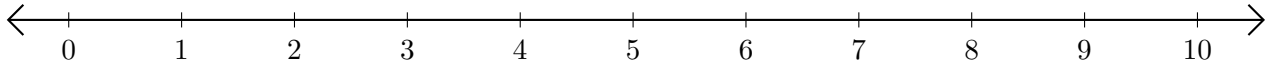
5. $10 - 1 =$ ___