Droites Numériques (H)

Complétez cette droite numérique par les nombres manquants.

1.

Différence commune: _____

2.

Différence commune: _____

3.



Différence commune: _____

4.

Différence commune: _____

5.



Différence commune: _____

6.



Différence commune: _____

7.

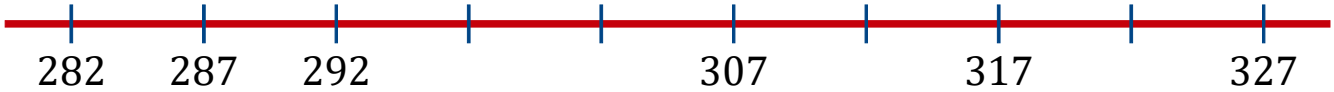

Différence commune: _____

8.

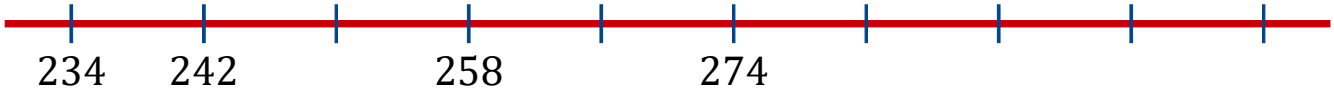

Différence commune: _____