Droites Numériques (C)

Complétez cette droite numérique par les nombres manquants.

1.

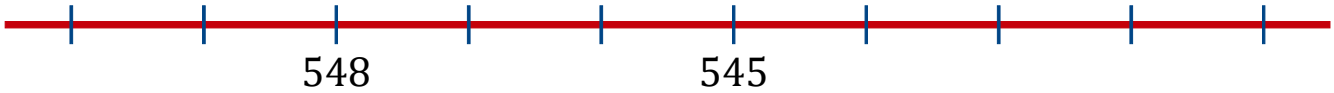

Différence commune: _____

2.

Différence commune: _____

3.

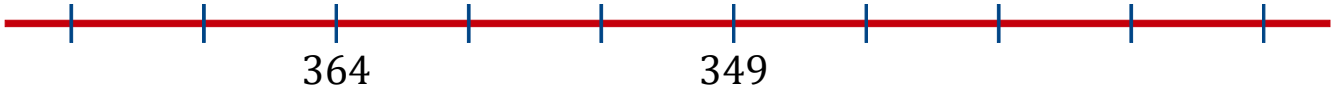

Différence commune: _____

4.

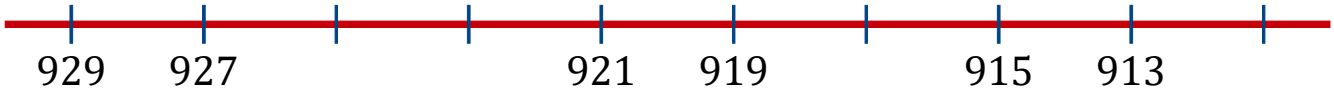

Différence commune: _____

5.

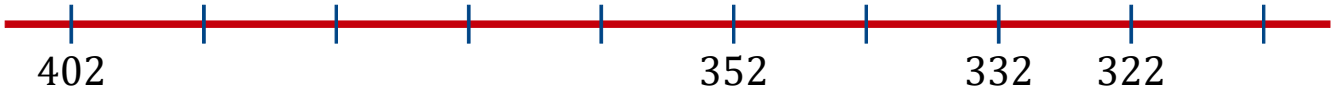

Différence commune: _____

6.



Différence commune: _____

7.

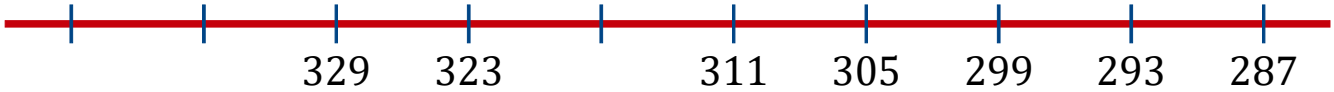

Différence commune: _____

8.

Différence commune: _____