Lecture de Nombres sur une Droite Graduée (F)

Déterminez les termes et la somme (résultat) représentés sur chaque droite graduée.

1. _____ + _____ = _____

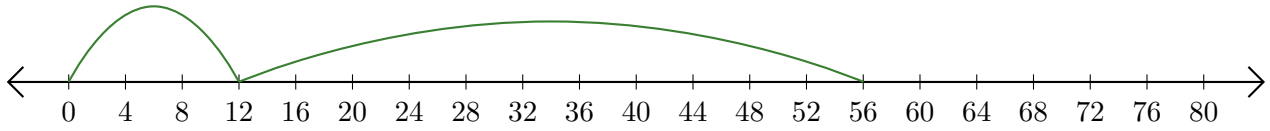

2. ___ + _____ = _____

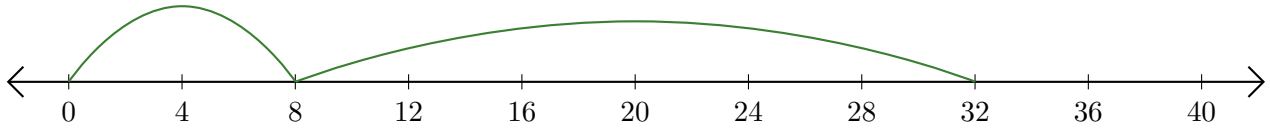

3. _____ + _____ = _____

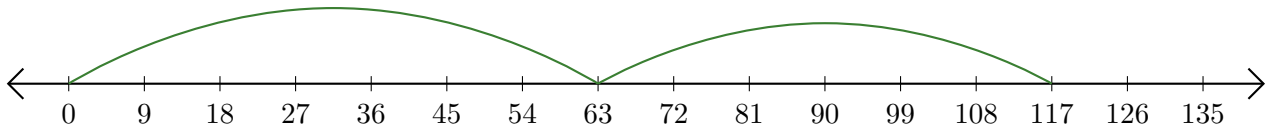

4. _____ + _____ = _____

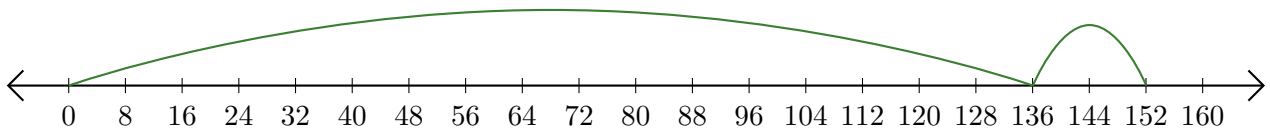

5. _____ + ___ = _____



Lecture de Nombres sur une Droite Graduée (F) Réponses

Déterminez les termes et la somme (résultat) représentés sur chaque droite graduée.

1. 12 + 44 = 56

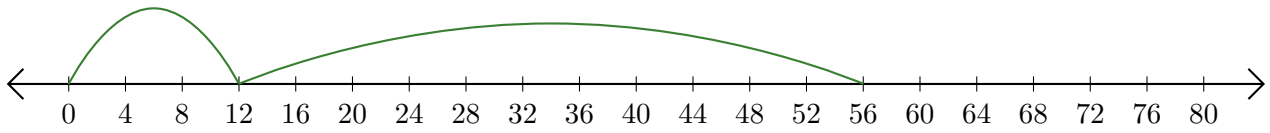

2. 8 + 24 = 32

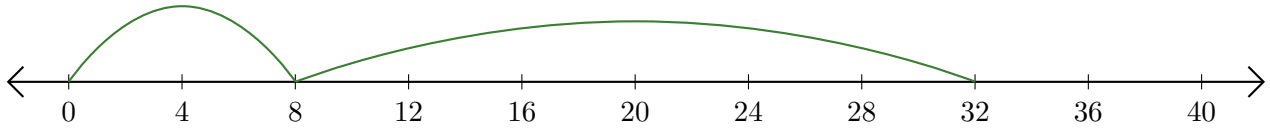

3. 63 + 54 = 117

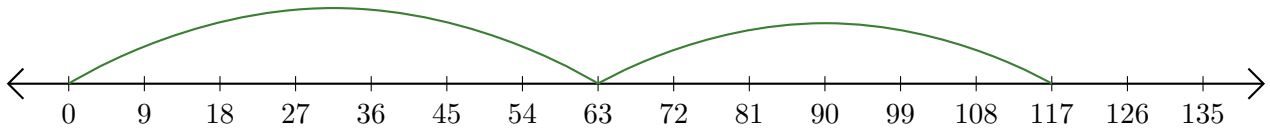

4. 136 + 16 = 152

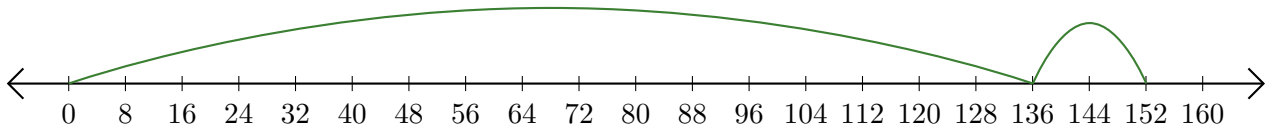

5. 35 + 5 = 40