Lecture de Nombres sur une Droite Graduée (G)

Déterminez les termes et la différence (résultat) représentés sur chaque droite graduée.

1. _____ − _____ = _____

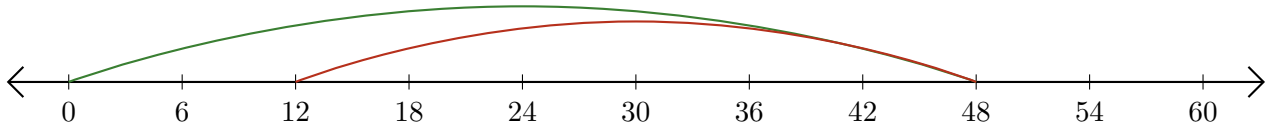

2. _____ − _____ = _____

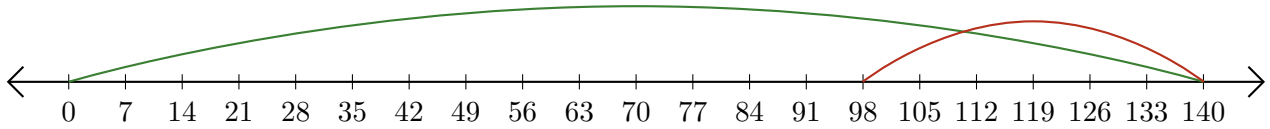

3. _____ − _____ = ___

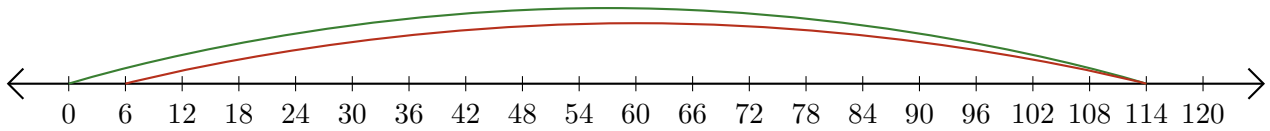

4. _____ − _____ = ___

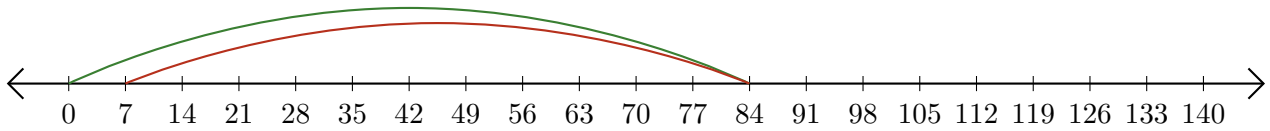

5. _____ − _____ = ___