Lecture de Nombres sur une Droite Graduée (H)

Déterminez la question que chaque droite graduée démontre.

1. _____ + ___ = _____

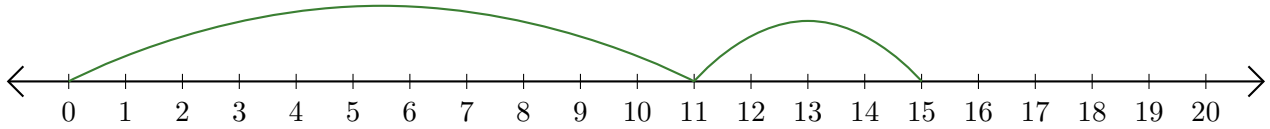

2. ___ + ___ = ___



3. _____ + ___ = _____

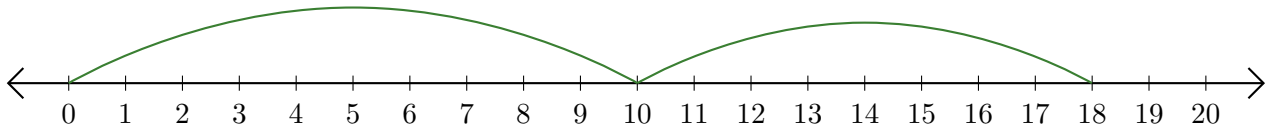

4. _____ + ___ = _____

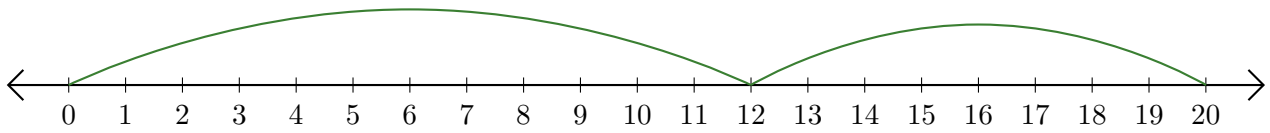

5. _____ + ___ = _____

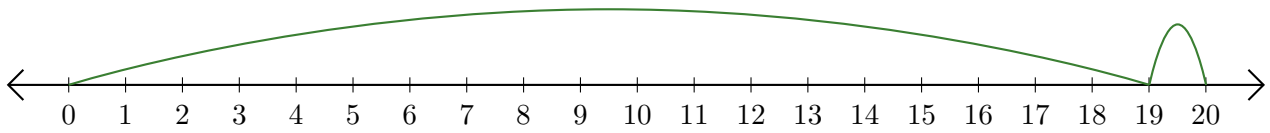

Lecture de Nombres sur une Droite Graduée (H) Réponses

Déterminez la question que chaque droite graduée démontre.

1. 11 + 4 = 15

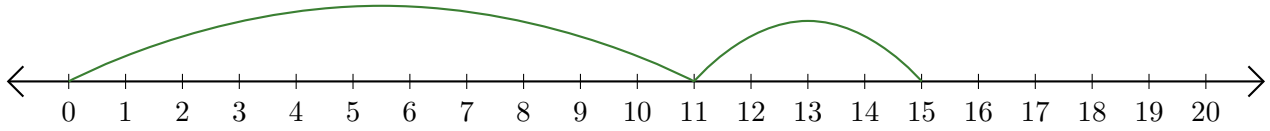

2. 5 + 1 = 6



3. 10 + 8 = 18

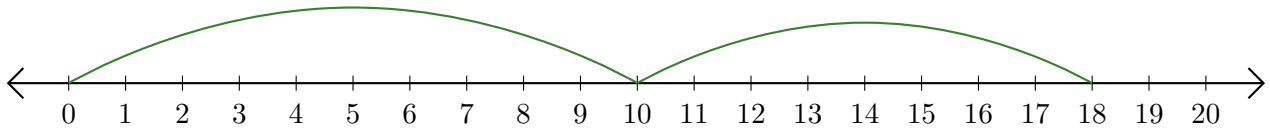

4. 12 + 8 = 20

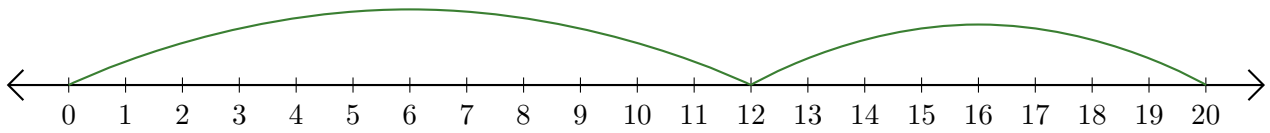
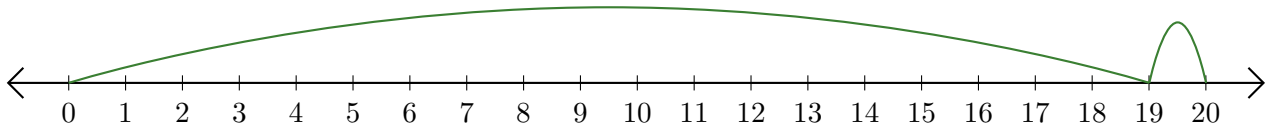
5. 19 + 1 = 20