Addition de Nombres sur une Droite Graduée (D)

Utlisez la droite graduée pour calculer chaque somme.

1. $10 + 5 =$ ____

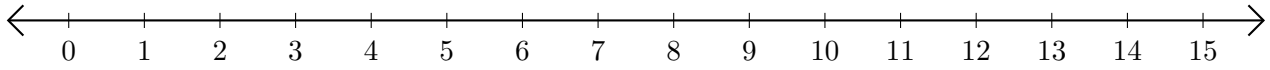

2. $12 + 12 =$ ____

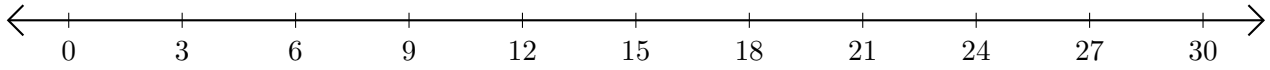

3. $8 + 8 =$ ____

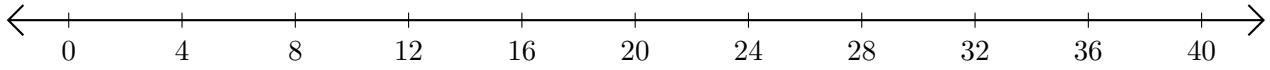

4. $42 + 3 =$ ____

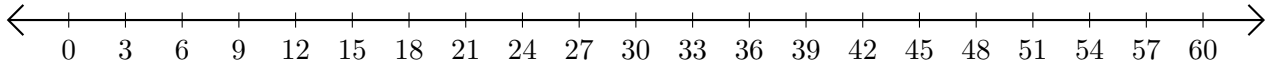
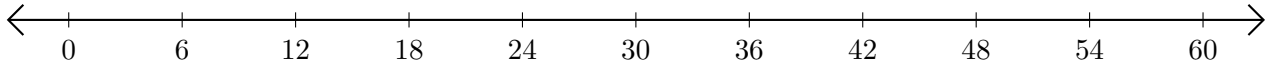
5. $6 + 30 =$ ____