# Addition de Nombres sur une Droite Graduée (D)

Utlisez la droite graduée pour calculer chaque somme.

1. $10 + 5 =$ ____

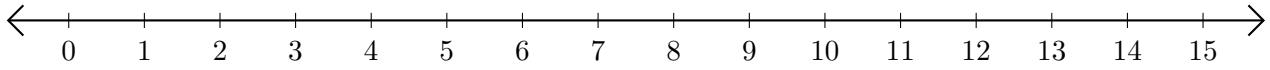


2. $12 + 12 =$ ____

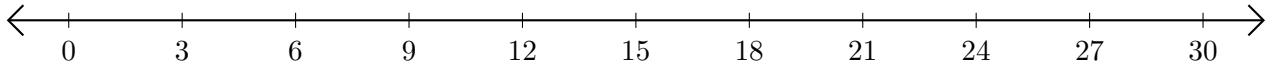


3. $8 + 8 =$ ____

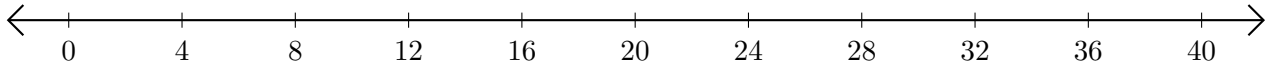


4. $42 + 3 =$ ____

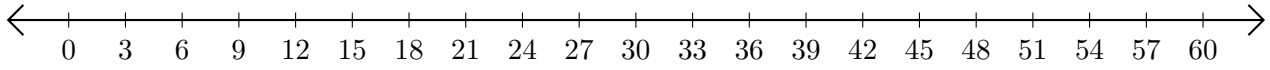


5. $6 + 30 =$ ____

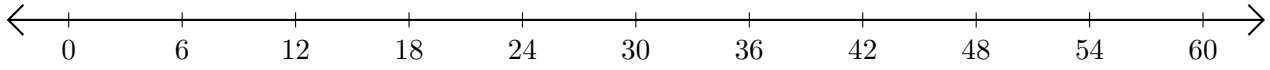

# Addition de Nombres sur une Droite Graduée (D) Réponses

Utlisez la droite graduée pour calculer chaque somme.

1. $10 + 5 =$ 15

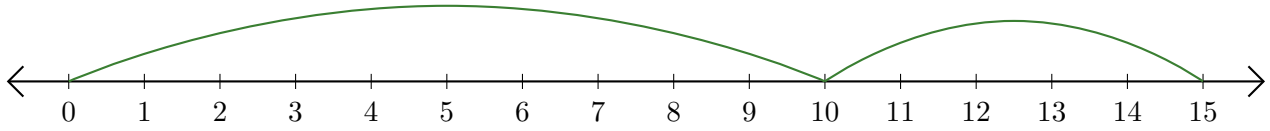


2. $12 + 12 =$ 24

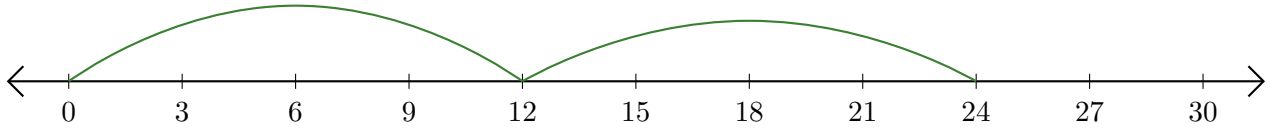


3. $8 + 8 =$ 16

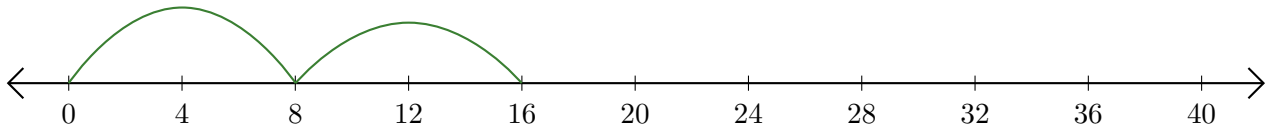


4. $42 + 3 =$ 45

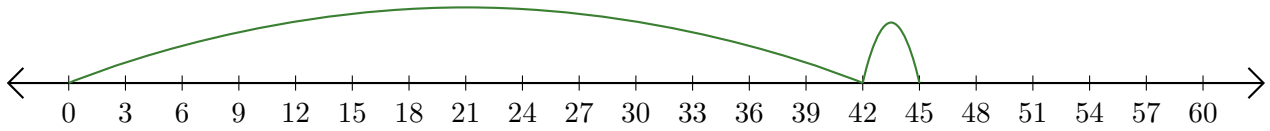

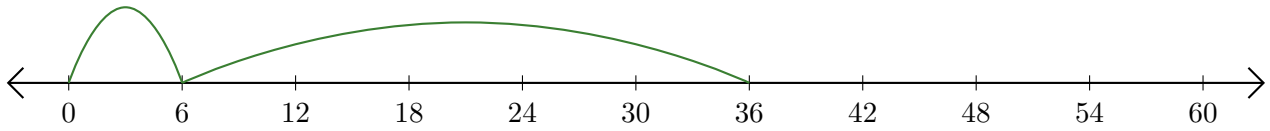
5. $6 + 30 =$ 36