Addition de Nombres sur une Droite Graduée (E)

Utlisez la droite graduée pour calculer chaque somme.

1. $25 + 15 =$ ____

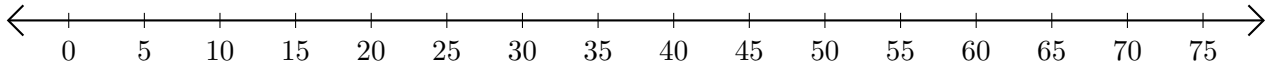

2. $40 + 10 =$ ____

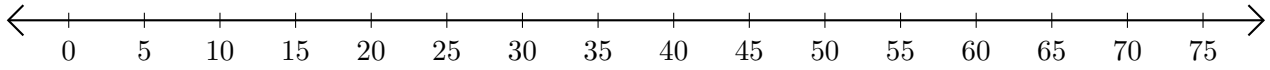

3. $10 + 65 =$ ____

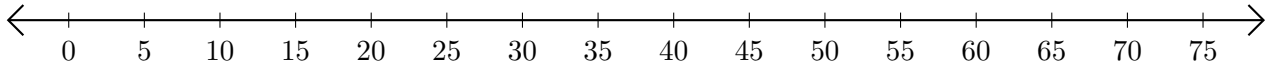

4. $65 + 10 =$ ____

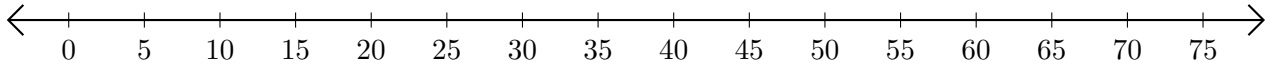
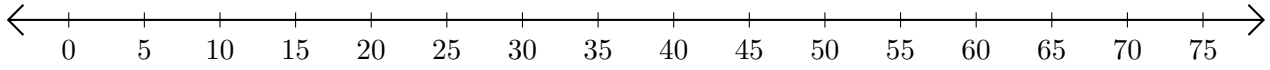
5. $30 + 25 =$ ____