Addition de Nombres sur une Droite Graduée (I)

Utlisez la droite graduée pour calculer chaque somme.

1. $15 + 30 =$ ____

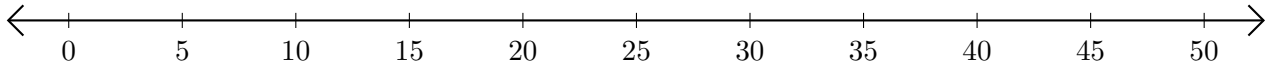

2. $40 + 5 =$ ____

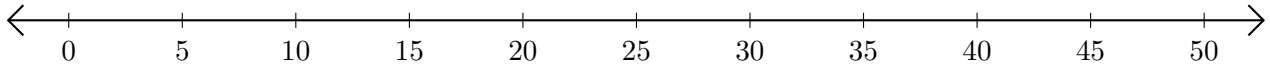

3. $35 + 10 =$ ____

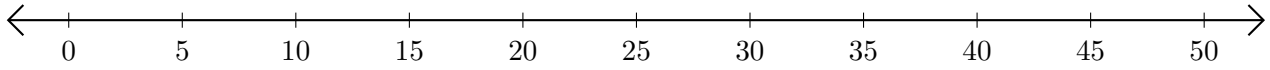

4. $45 + 5 =$ ____

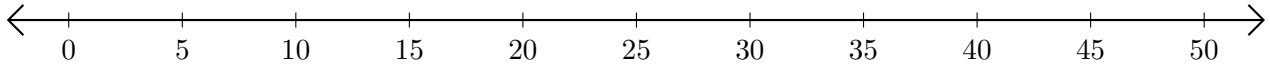

5. $5 + 20 =$ ____

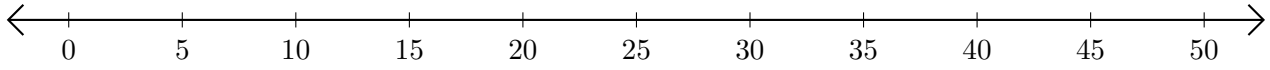

Addition de Nombres sur une Droite Graduée (I) Réponses

Utlisez la droite graduée pour calculer chaque somme.

1. $15 + 30 =$ 45

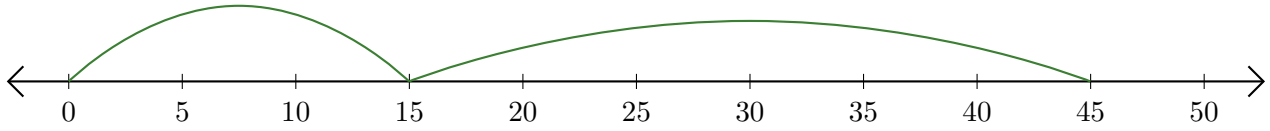

2. $40 + 5 =$ 45

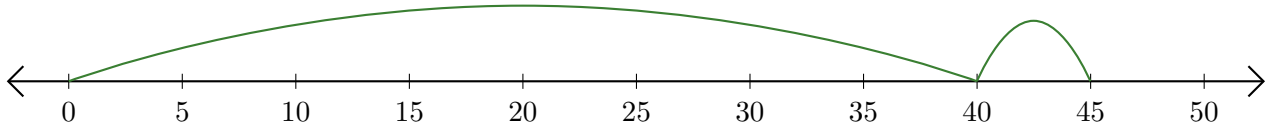

3. $35 + 10 =$ 45

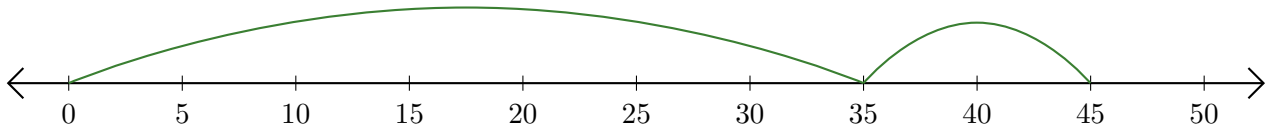

4. $45 + 5 =$ 50

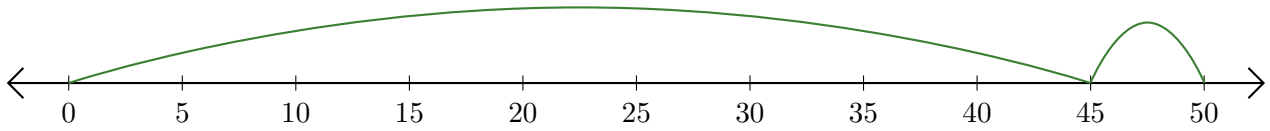
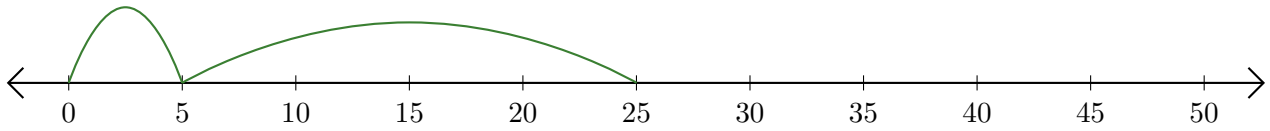
5. $5 + 20 =$ 25