Addition de Nombres sur une Droite Graduée (E)

Utlisez la droite graduée pour calculer chaque somme.

1. $20 + 4 =$ ____

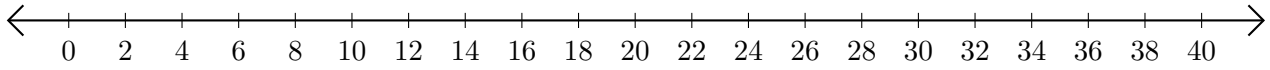

2. $34 + 6 =$ ____

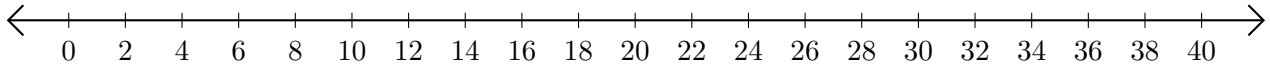

3. $14 + 20 =$ ____

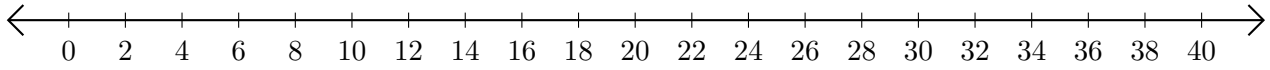

4. $18 + 14 =$ ____

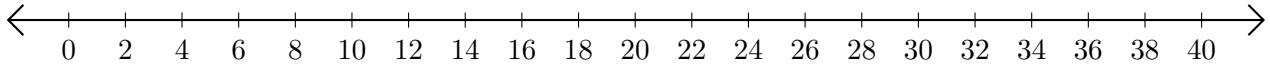
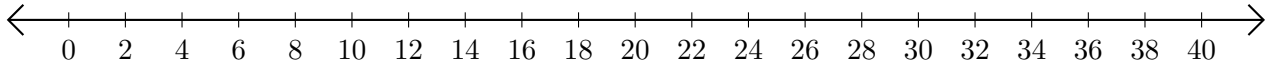
5. $38 + 2 =$ ____