Addition de Nombres sur une Droite Graduée (C)

Utlisez la droite graduée pour calculer chaque somme.

1. $30 + 2 =$ ____

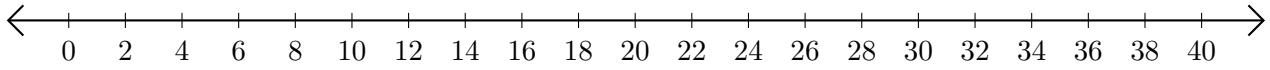

2. $10 + 18 =$ ____

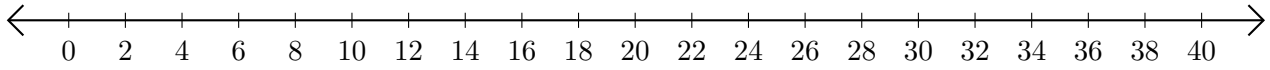

3. $26 + 2 =$ ____

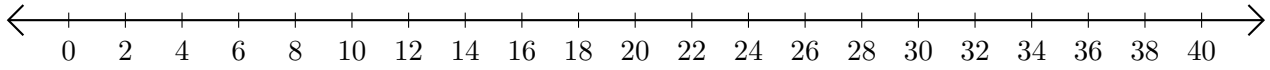

4. $38 + 2 =$ ____

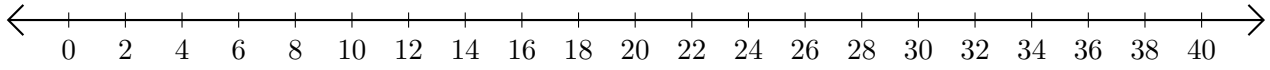
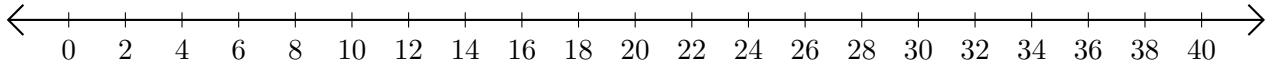
5. $16 + 2 =$ ____