Addition de Nombres sur une Droite Graduée (J)

Utlisez la droite graduée pour calculer chaque somme.

1. $18 + 6 =$ ____

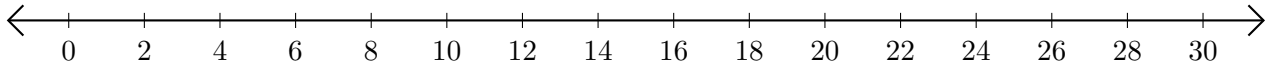

2. $14 + 8 =$ ____

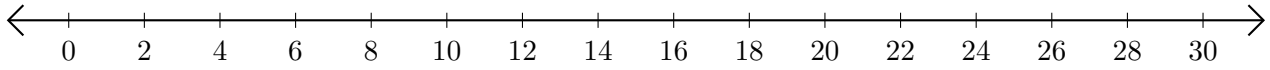

3. $24 + 2 =$ ____

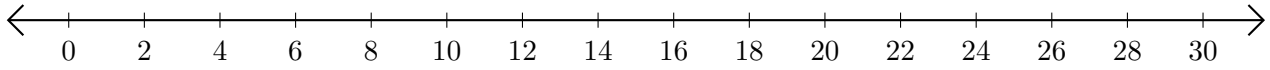

4. $20 + 10 =$ ____

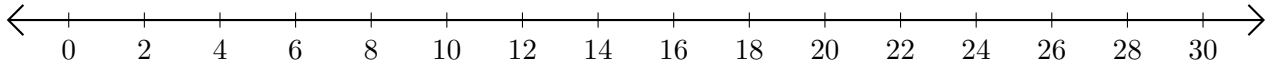
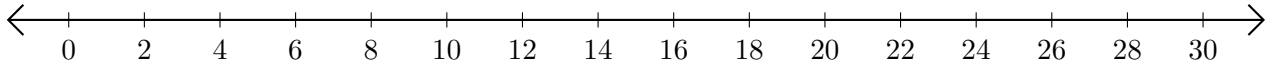
5. $22 + 2 =$ ____