Addition de Nombres sur une Droite Graduée (F)

Utlisez la droite graduée pour calculer chaque somme.

1. $6 + 10 =$ ____

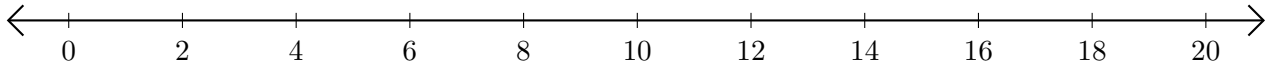

2. $12 + 4 =$ ____

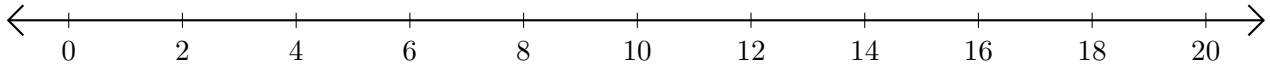

3. $8 + 12 =$ ____

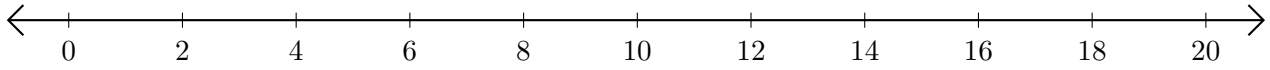

4. $14 + 2 =$ ____

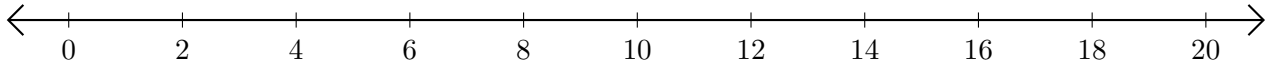

5. $10 + 2 =$ ____

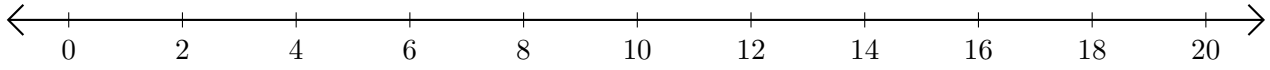

Addition de Nombres sur une Droite Graduée (F) Réponses

Utlisez la droite graduée pour calculer chaque somme.

1. $6 + 10 =$ 16

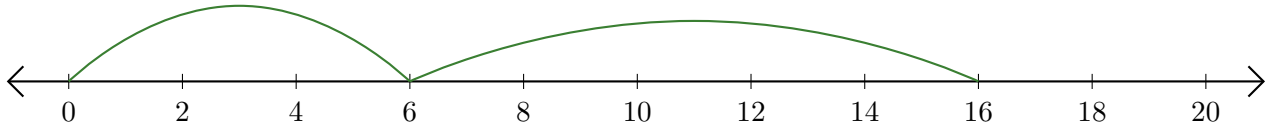

2. $12 + 4 =$ 16

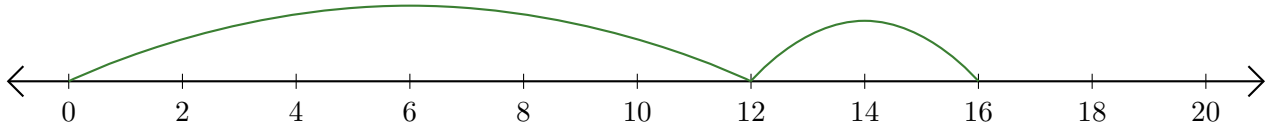

3. $8 + 12 =$ 20

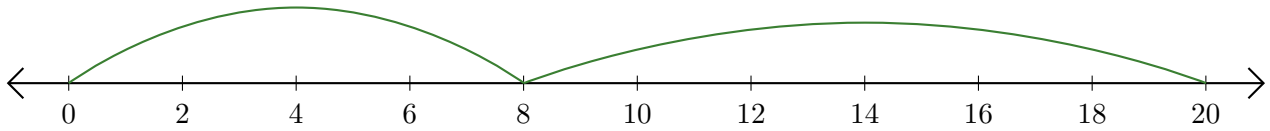

4. $14 + 2 =$ 16

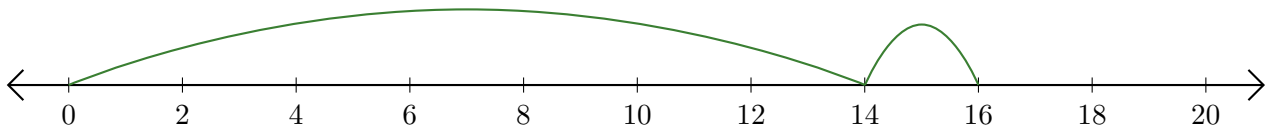
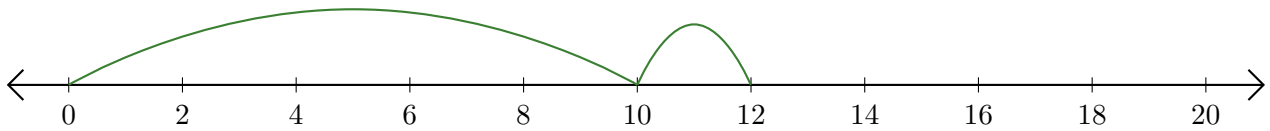
5. $10 + 2 =$ 12