Addition de Nombres sur une Droite Graduée (A)

Utlisez la droite graduée pour calculer chaque somme.

1. $2 + 2 =$ ___

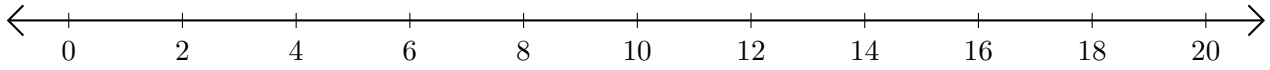

2. $18 + 2 =$ ____

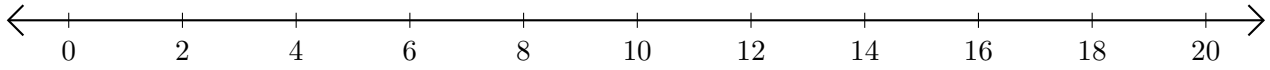

3. $16 + 4 =$ ____

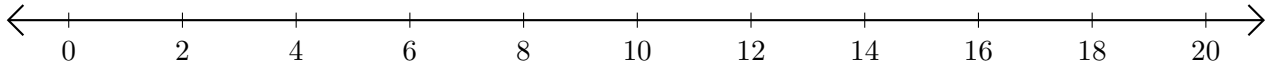

4. $10 + 10 =$ ____

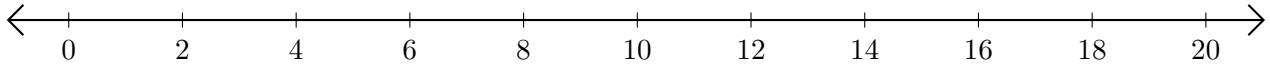
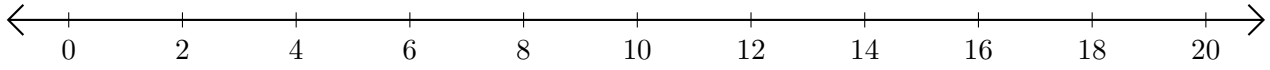
5. $4 + 12 =$ ____