Addition de Nombres sur une Droite Graduée (J)

Utlisez la droite graduée pour calculer chaque somme.

1. $14 + 5 =$ ____

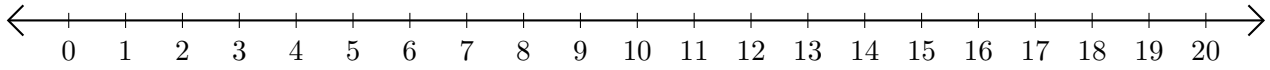

2. $13 + 1 =$ ____

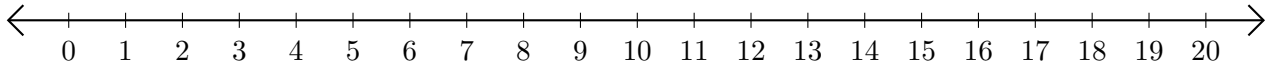

3. $16 + 1 =$ ____

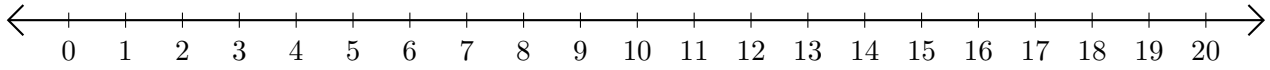

4. $3 + 1 =$ ___

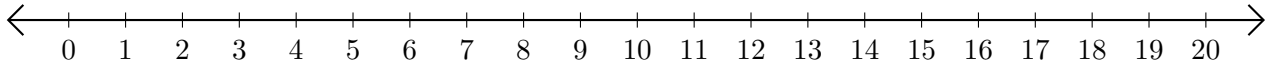

5. $4 + 8 =$ ____

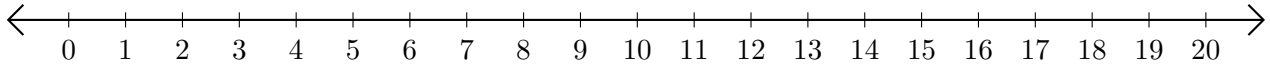

Addition de Nombres sur une Droite Graduée (J) Réponses

Utlisez la droite graduée pour calculer chaque somme.

1. $14 + 5 =$ 19

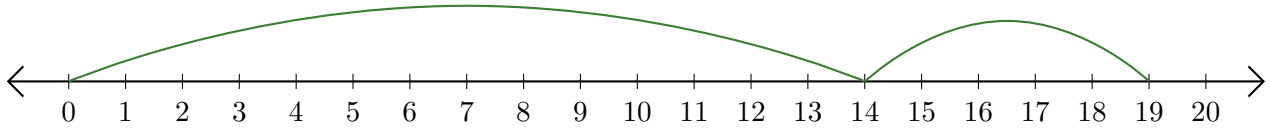

2. $13 + 1 =$ 14

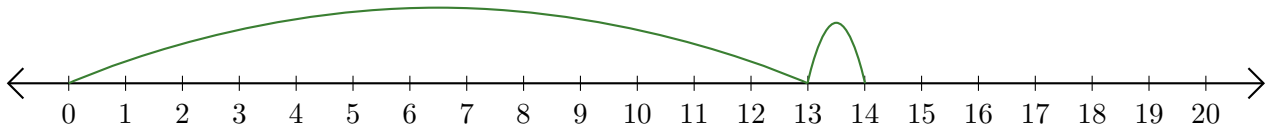

3. $16 + 1 =$ 17

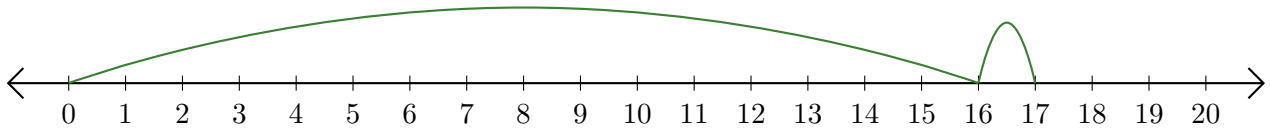

4. $3 + 1 =$ 4

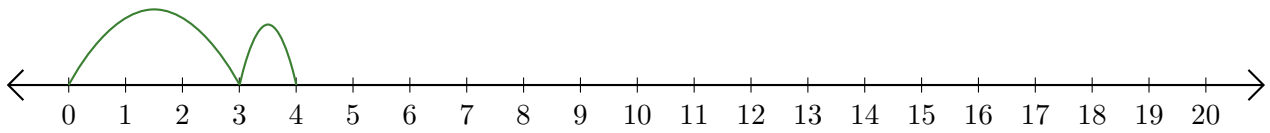
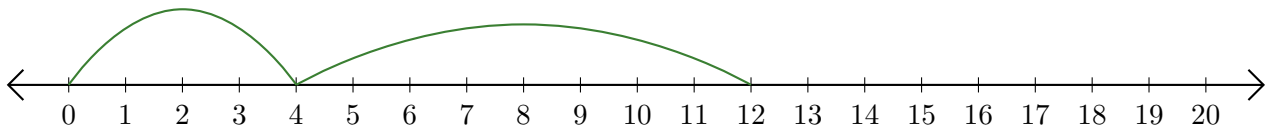
5. $4 + 8 =$ 12