Addition de Nombres sur une Droite Graduée (C)

Utlisez la droite graduée pour calculer chaque somme.

1. $8 + 10 =$ ____

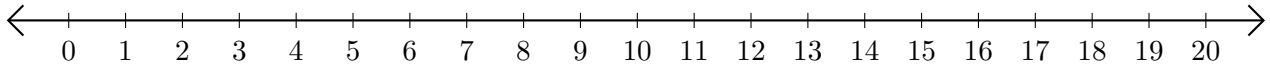

2. $15 + 3 =$ ____

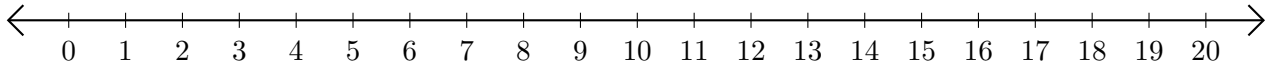

3. $2 + 1 =$ ___

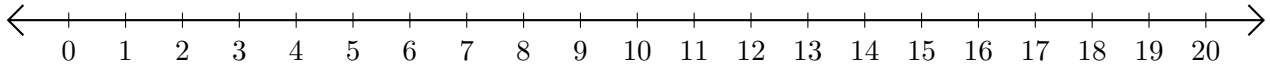

4. $7 + 4 =$ ____

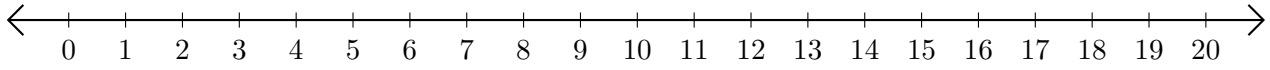
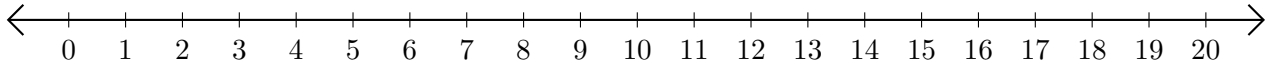
5. $1 + 4 =$ ___