Addition de Nombres sur une Droite Graduée (E)

Utlisez la droite graduée pour calculer chaque somme.

1. $3 + 8 =$ ____

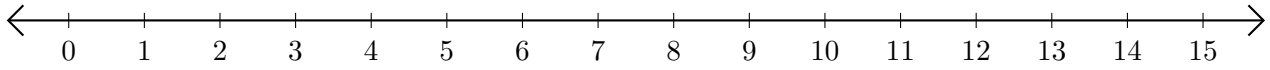

2. $13 + 1 =$ ____

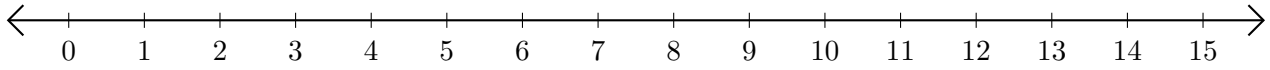

3. $8 + 5 =$ ____

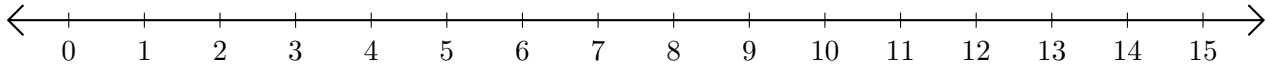

4. $5 + 3 =$ ___

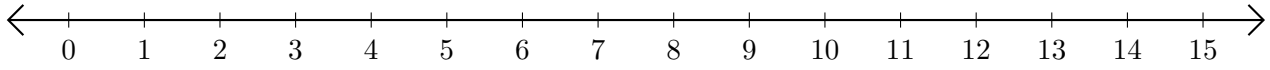
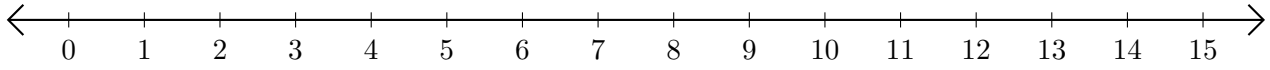
5. $9 + 3 =$ ____