Addition de Nombres sur une Droite Graduée (C)

Utlisez la droite graduée pour calculer chaque somme.

1. $1 + 6 =$ ___

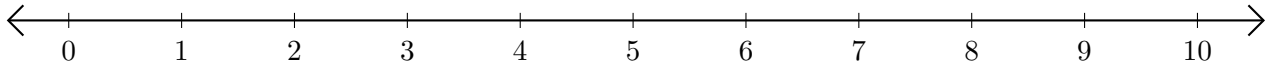

2. $8 + 1 =$ ___

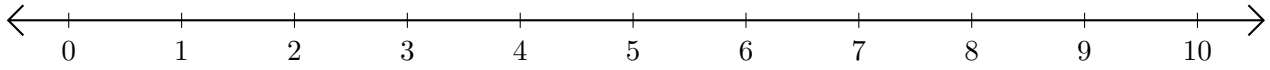

3. $3 + 1 =$ ___

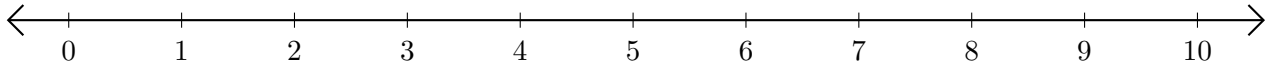

4. $7 + 1 =$ ___

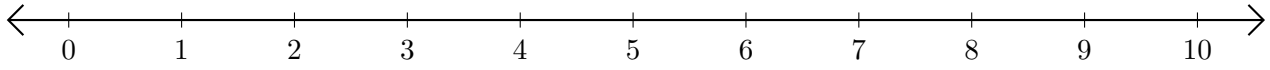

5. $9 + 1 =$ ____

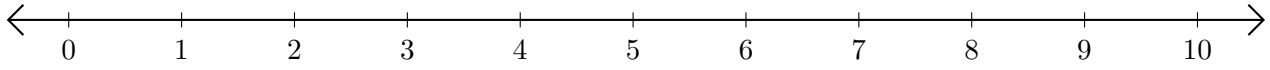

Addition de Nombres sur une Droite Graduée (C) Réponses

Utlisez la droite graduée pour calculer chaque somme.

1. $1 + 6 =$ 7

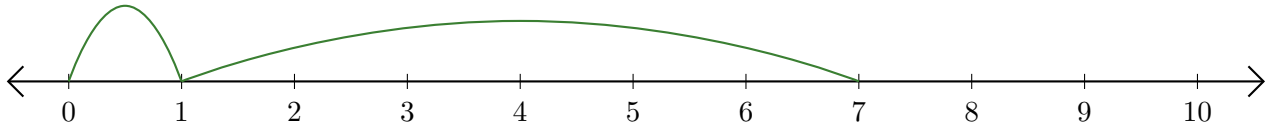

2. $8 + 1 =$ 9

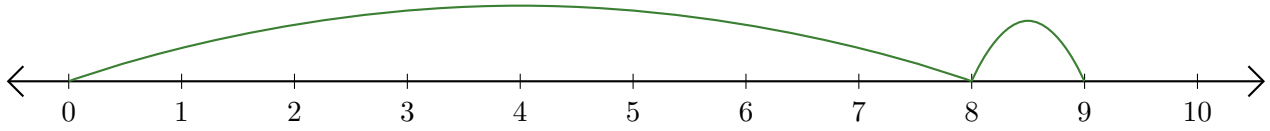

3. $3 + 1 =$ 4

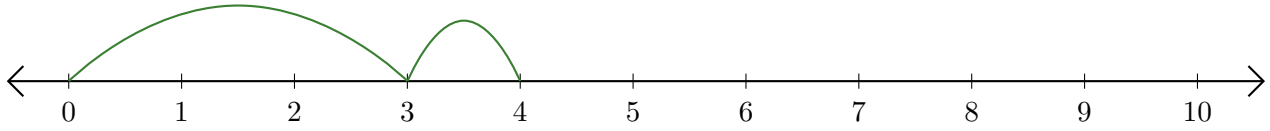

4. $7 + 1 =$ 8

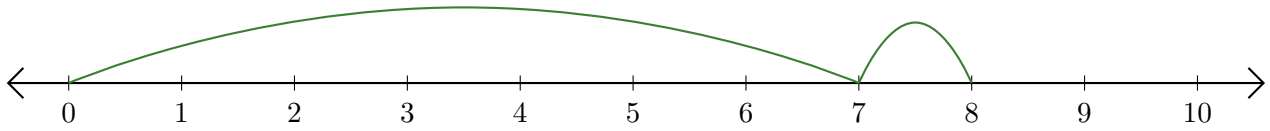
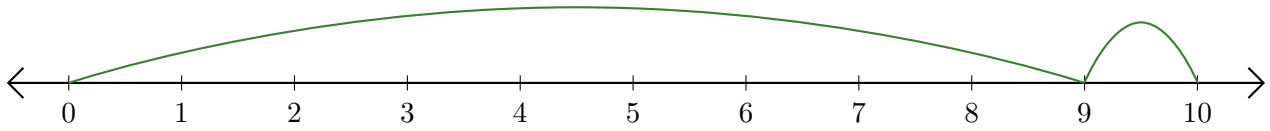
5. $9 + 1 =$ 10