Addition de Nombres sur une Droite Graduée (J)

Utlisez la droite graduée pour calculer chaque somme.

1. $70 + 30 =$ _____

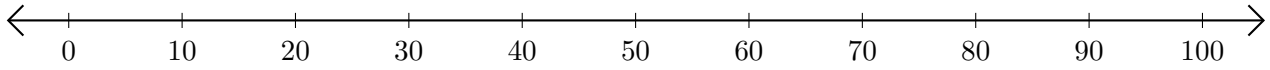

2. $10 + 20 =$ ____

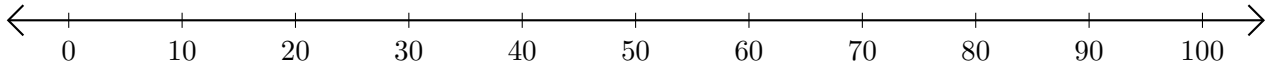

3. $30 + 30 =$ ____

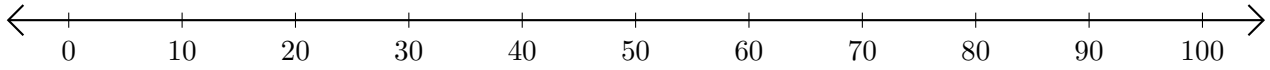

4. $90 + 10 =$ _____

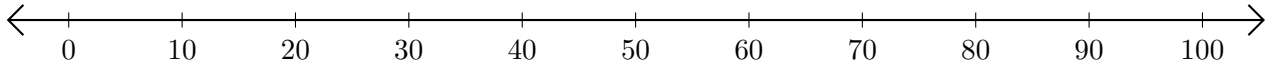
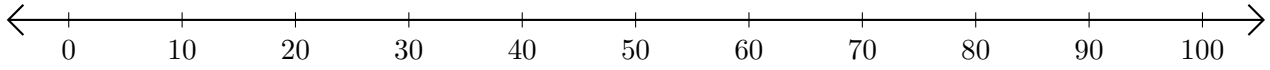
5. $60 + 40 =$ _____