Addition de Nombres sur une Droite Graduée (D)

Utlisez la droite graduée pour calculer chaque somme.

1. $70 + 10 =$ ____

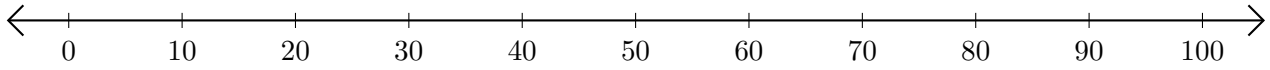

2. $90 + 10 =$ _____

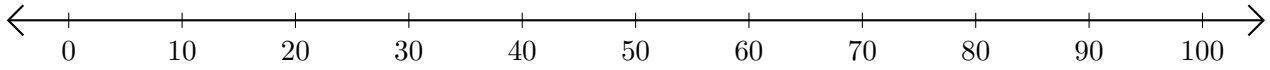

3. $10 + 60 =$ ____

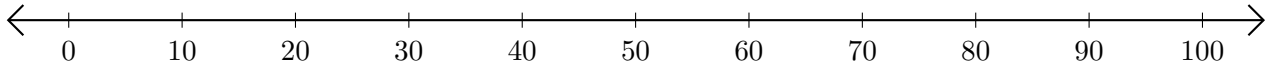

4. $30 + 70 =$ _____

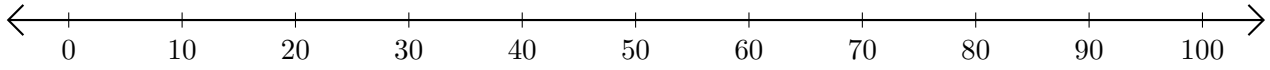
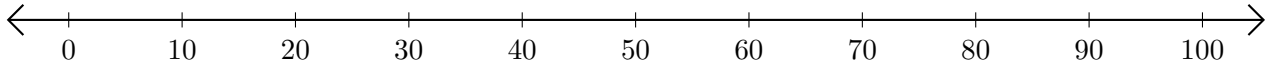
5. $50 + 40 =$ ____