Opérations sur Une Droite Graduée (F)

Utlisez la droite graduée pour calculer chaque somme ou différence.

1. $112 + 8 =$ _____

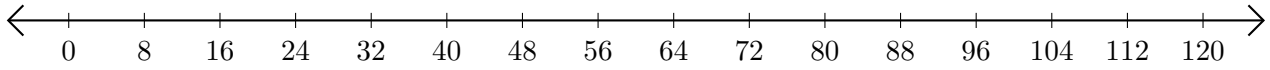

2. $99 - 90 =$ ___

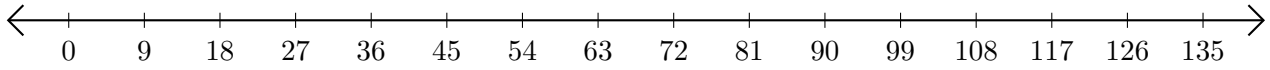

3. $8 + 4 =$ ____

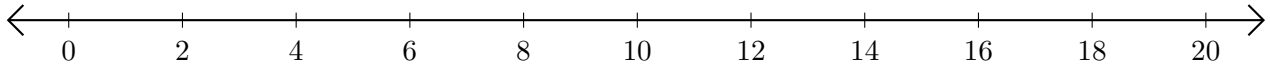

4. $8 - 7 =$ ___

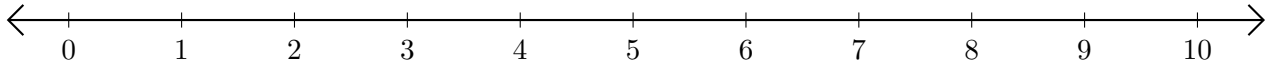

5. $45 + 5 =$ ____

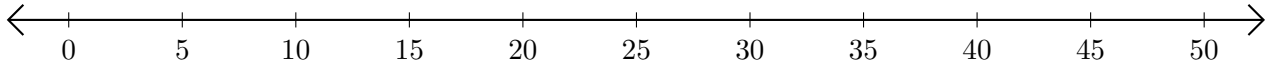

Opérations sur Une Droite Graduée (F) Réponses

Utlisez la droite graduée pour calculer chaque somme ou différence.

1. $112 + 8 =$ 120

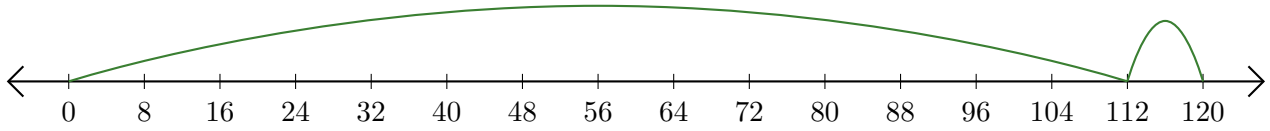

2. $99 - 90 =$ 9

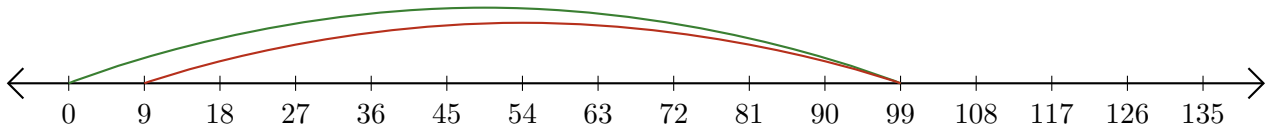

3. $8 + 4 =$ 12

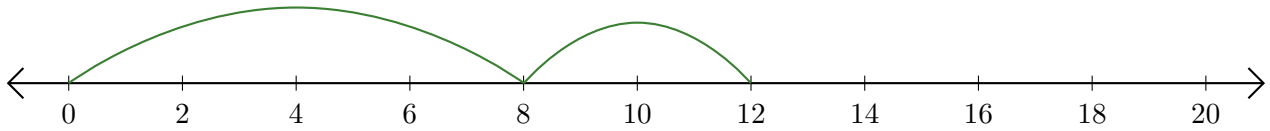

4. $8 - 7 =$ 1

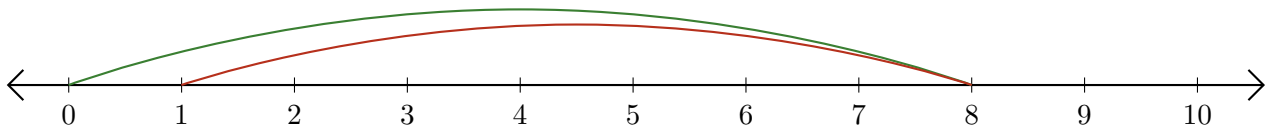
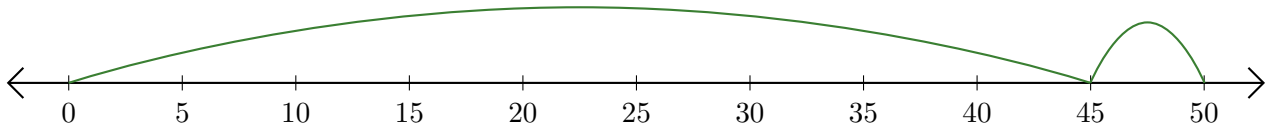
5. $45 + 5 =$ 50