Opérations sur Une Droite Graduée (H)

Utlisez la droite graduée pour calculer chaque somme ou différence.

1. $40 + 30 =$ ____

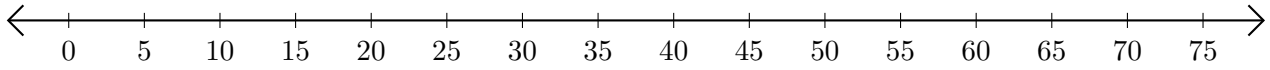

2. $75 - 60 =$ ____

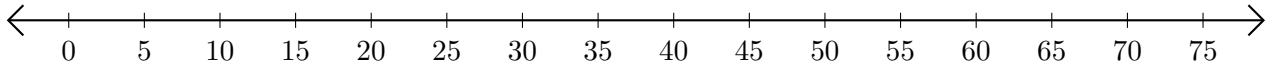

3. $30 + 35 =$ ____

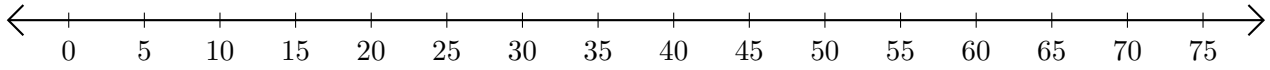

4. $65 - 35 =$ ____

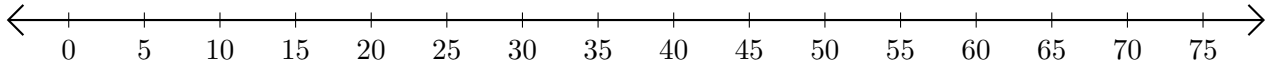

5. $25 - 20 =$ ___

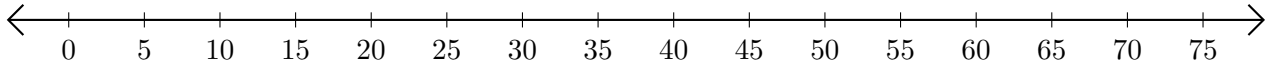

Opérations sur Une Droite Graduée (H) Réponses

Utlisez la droite graduée pour calculer chaque somme ou différence.

1. $40 + 30 =$ 70

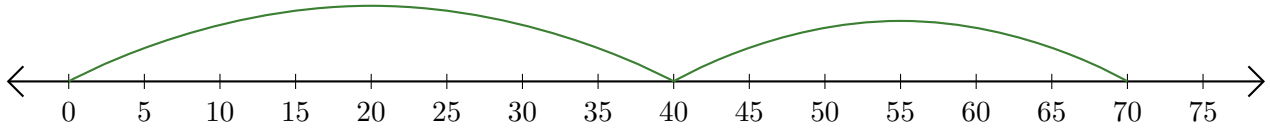

2. $75 - 60 =$ 15

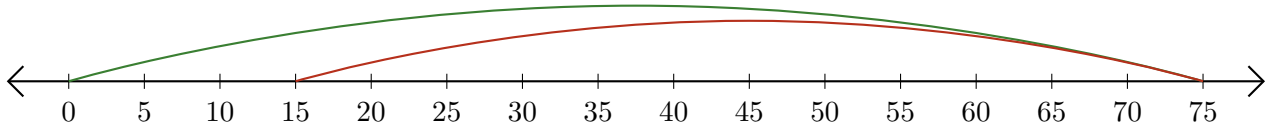

3. $30 + 35 =$ 65

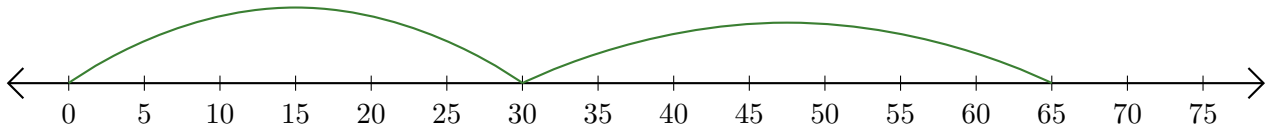

4. $65 - 35 =$ 30

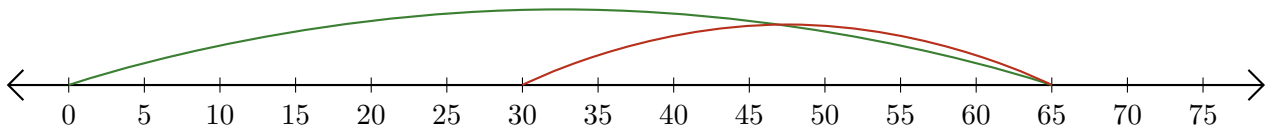

5. $25 - 20 =$ 5