Opérations sur Une Droite Graduée (G)

Utlisez la droite graduée pour calculer chaque somme ou différence.

1. $30 + 40 =$ ____

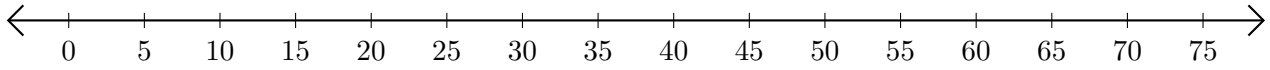

2. $75 - 70 =$ ___

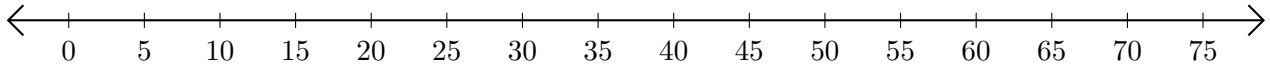

3. $25 + 10 =$ ____

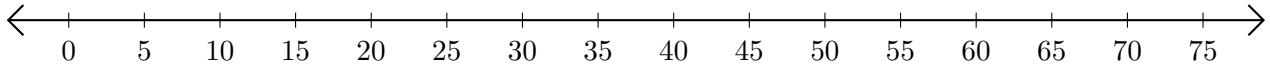

4. $70 - 35 =$ ____

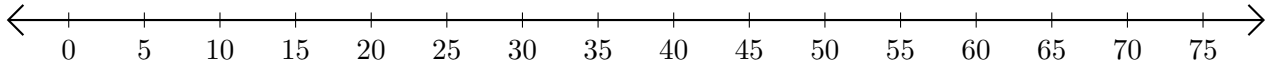
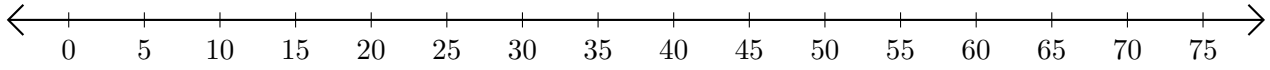
5. $15 + 60 =$ ____