Opérations sur Une Droite Graduée (A)

Utlisez la droite graduée pour calculer chaque somme ou différence.

1. $12 + 12 =$ ____

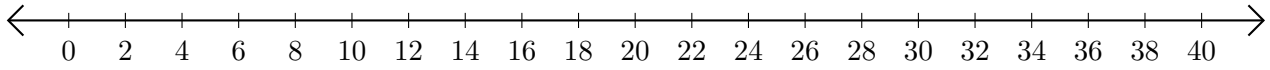

2. $40 - 30 =$ ____

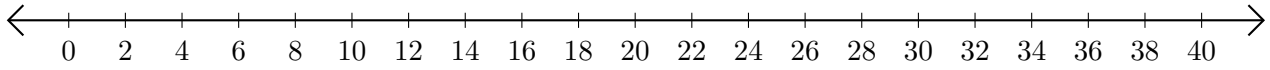

3. $28 + 10 =$ ____

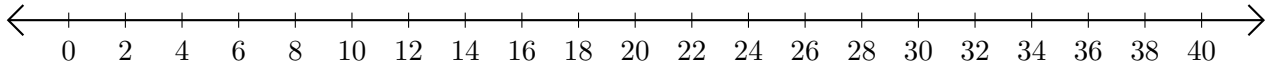

4. $38 - 36 =$ ___

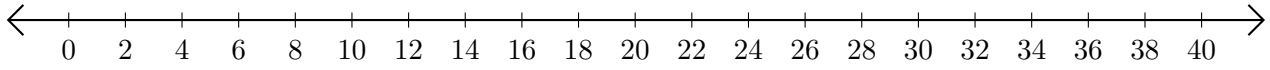
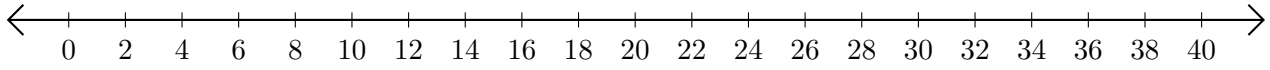
5. $20 + 2 =$ ____