Opérations sur Une Droite Graduée (I)

Utlisez la droite graduée pour calculer chaque somme ou différence.

1. $22 + 6 =$ ____

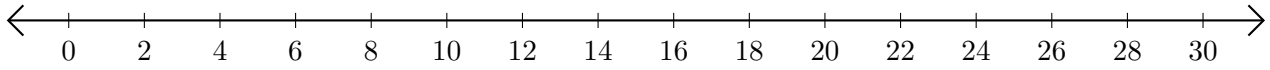

2. $22 - 14 =$ ___

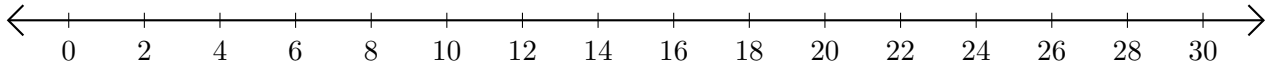

3. $16 + 6 =$ ____

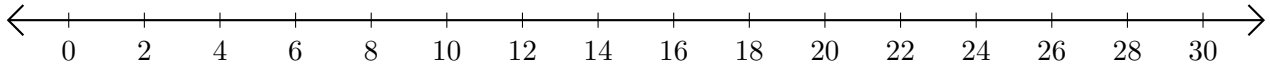

4. $20 - 18 =$ ___

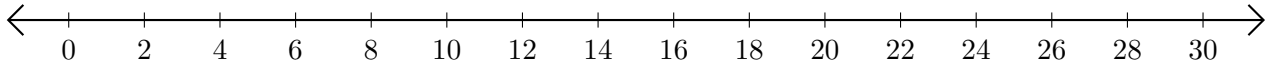

5. $6 + 16 =$ ____

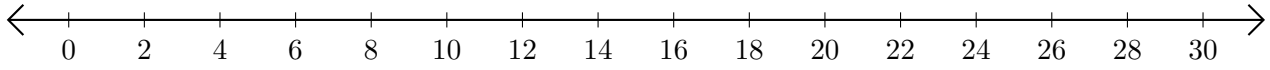

Opérations sur Une Droite Graduée (I) Réponses

Utlisez la droite graduée pour calculer chaque somme ou différence.

1. $22 + 6 =$ 28

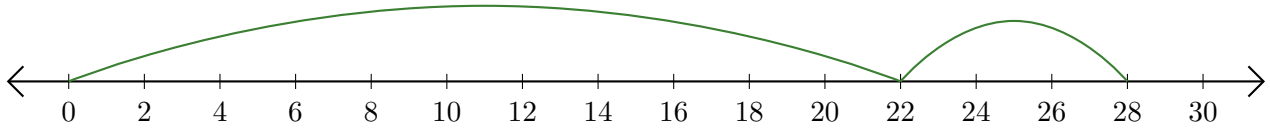

2. $22 - 14 =$ 8

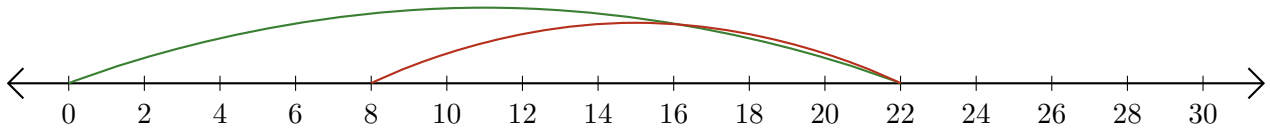

3. $16 + 6 =$ 22

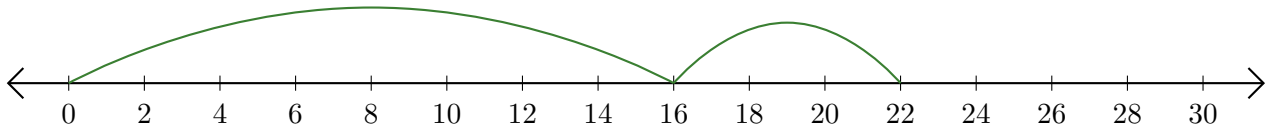

4. $20 - 18 =$ 2

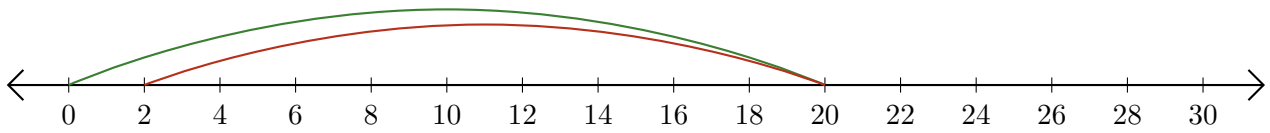
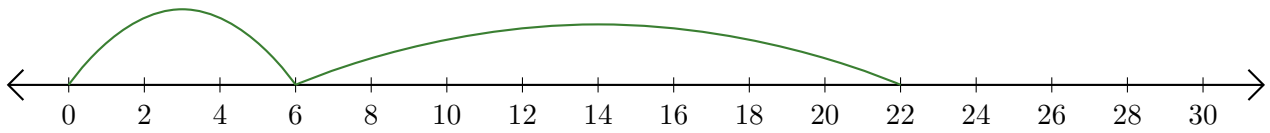
5. $6 + 16 =$ 22