Opérations sur Une Droite Graduée (H)

Utlisez la droite graduée pour calculer chaque somme ou différence.

1. $8 + 18 =$ ____

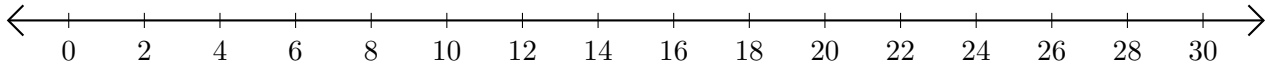

2. $22 - 14 =$ ___

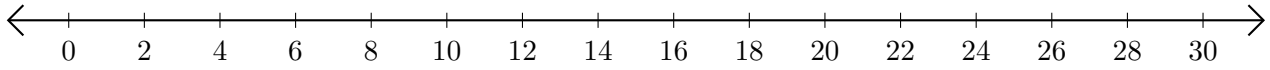

3. $10 + 16 =$ ____

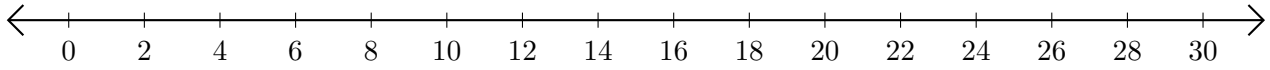

4. $28 - 26 =$ ___

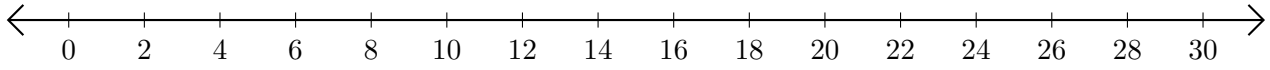
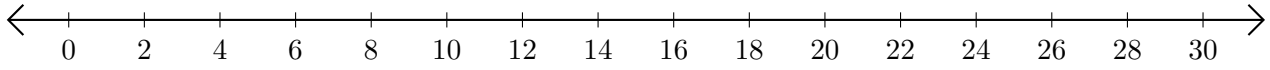
5. $22 + 8 =$ ____