Opérations sur Une Droite Graduée (G)

Utlisez la droite graduée pour calculer chaque somme ou différence.

1. $14 + 14 =$ ____

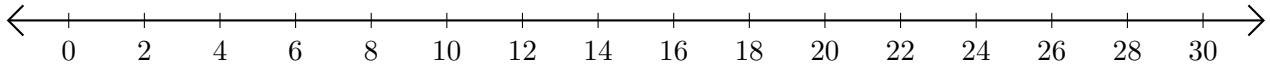

2. $22 - 18 =$ ___

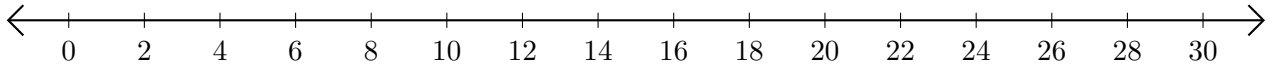

3. $16 + 14 =$ ____

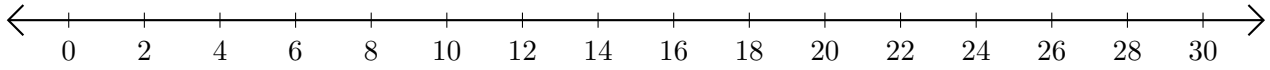

4. $16 - 2 =$ ____

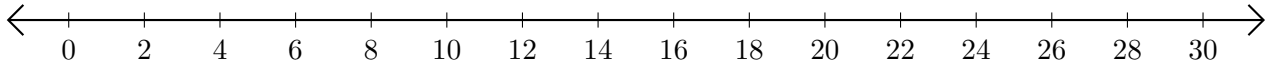
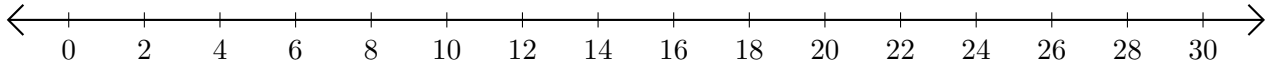
5. $16 - 4 =$ ____