Opérations sur Une Droite Graduée (J)

Utlisez la droite graduée pour calculer chaque somme ou différence.

1. $14 + 6 =$ ____

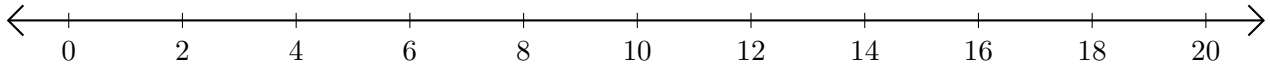

2. $20 - 10 =$ ____

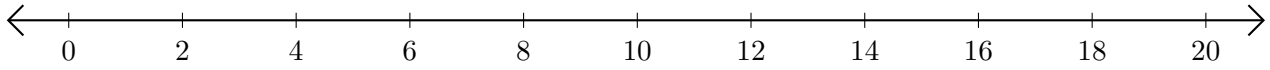

3. $12 + 4 =$ ____

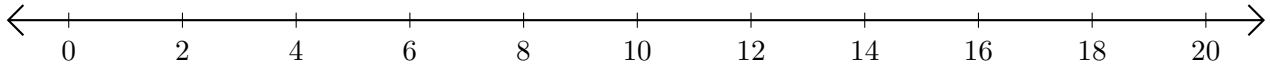

4. $20 - 18 =$ ___

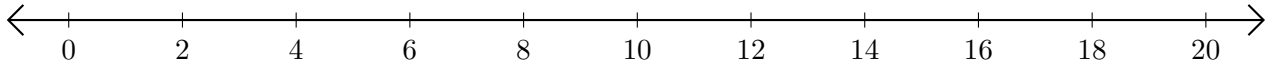

5. $8 + 2 =$ ____

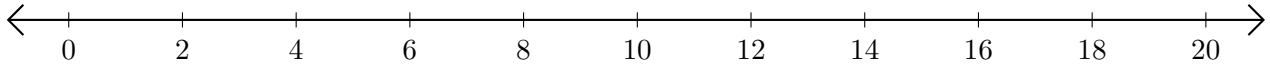

Opérations sur Une Droite Graduée (J) Réponses

Utlisez la droite graduée pour calculer chaque somme ou différence.

1. $14 + 6 =$ 20

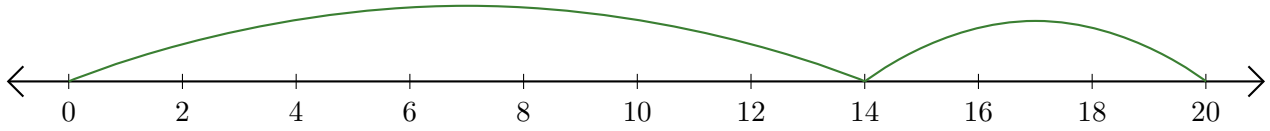

2. $20 - 10 =$ 10

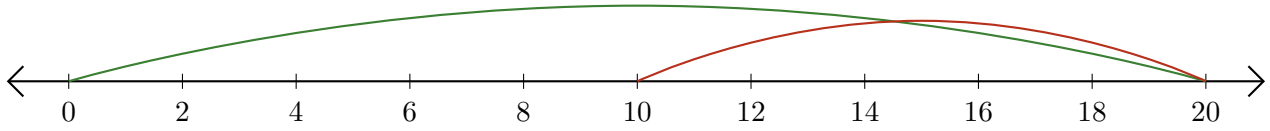

3. $12 + 4 =$ 16

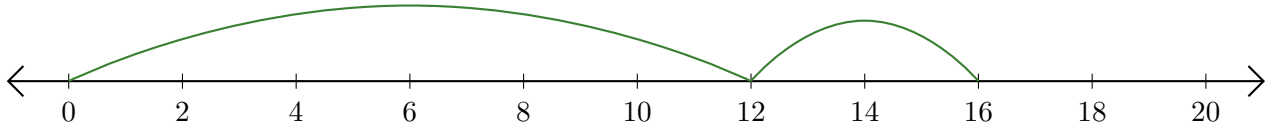

4. $20 - 18 =$ 2

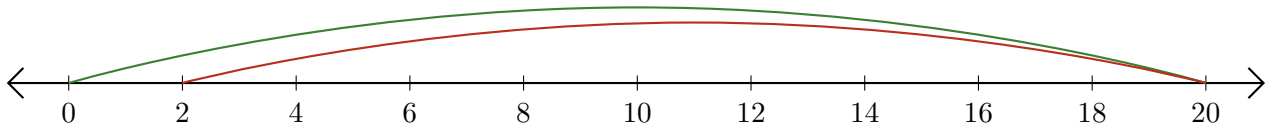
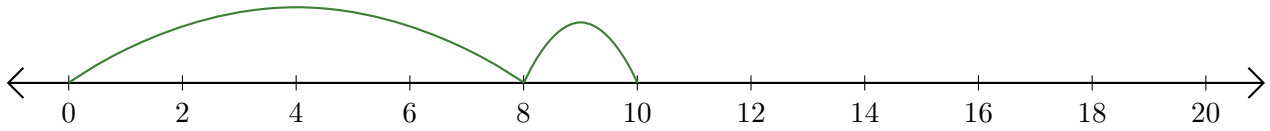
5. $8 + 2 =$ 10