Opérations sur Une Droite Graduée (H)

Utlisez la droite graduée pour calculer chaque somme ou différence.

1. $8 + 12 =$ ____

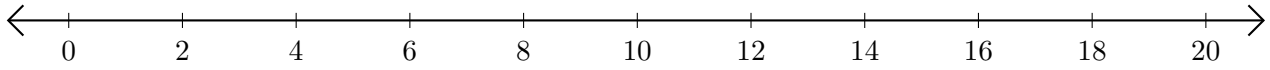

2. $20 - 16 =$ ___

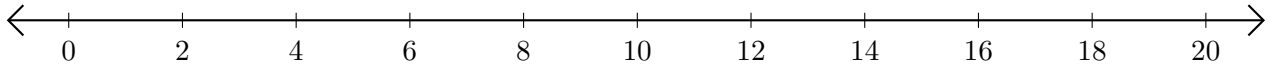

3. $14 + 6 =$ ____

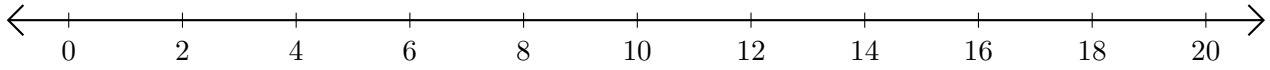

4. $14 - 12 =$ ___

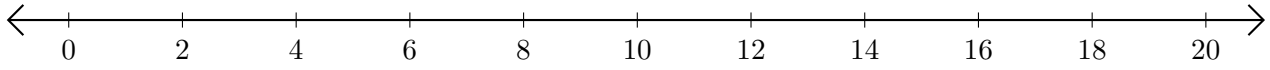
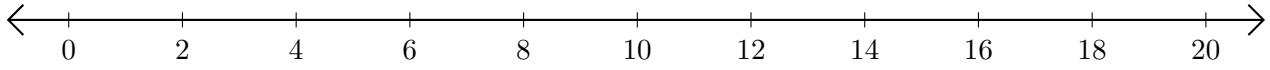
5. $18 - 10 =$ ___