Opérations sur Une Droite Graduée (I)

Utlisez la droite graduée pour calculer chaque somme ou différence.

1. $140 + 10 =$ _____

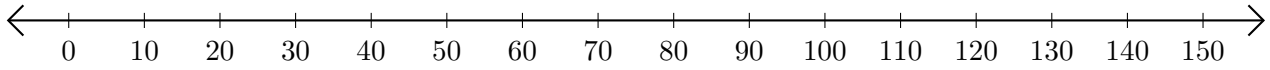

2. $130 - 70 =$ ____

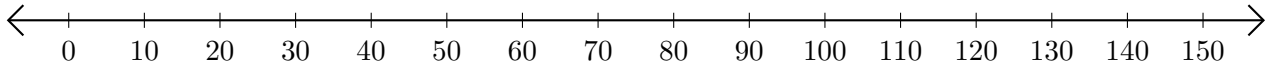

3. $20 + 130 =$ _____

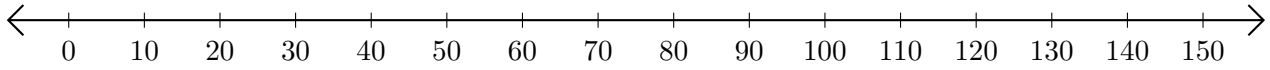

4. $150 - 120 =$ ____

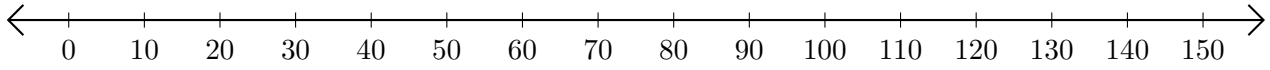

5. $80 + 70 =$ _____

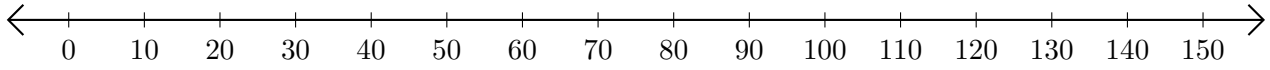

Opérations sur Une Droite Graduée (I) Réponses

Utlisez la droite graduée pour calculer chaque somme ou différence.

1. $140 + 10 =$ 150

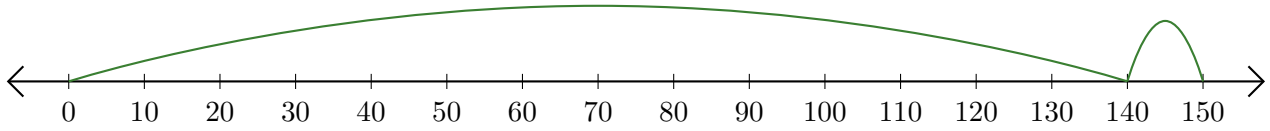

2. $130 - 70 =$ 60

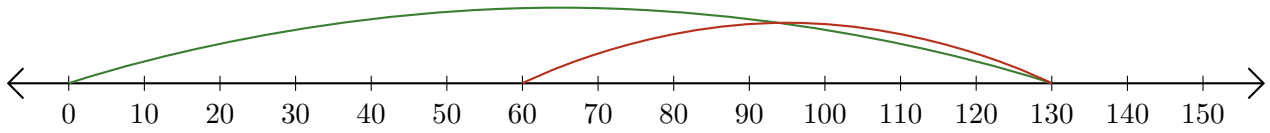

3. $20 + 130 =$ 150

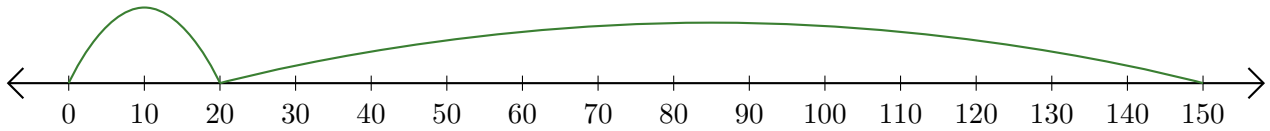

4. $150 - 120 =$ 30

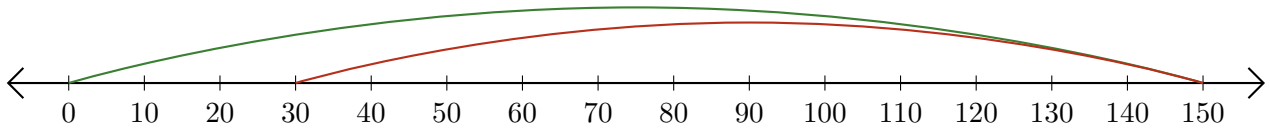
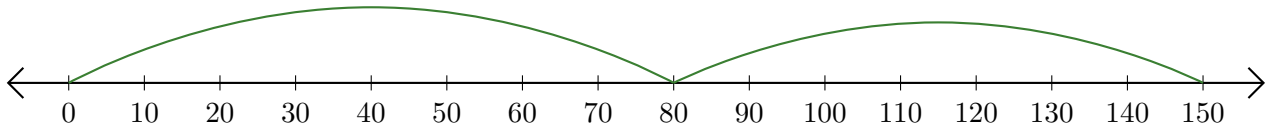
5. $80 + 70 =$ 150