Opérations sur Une Droite Graduée (H)

Utlisez la droite graduée pour calculer chaque somme ou différence.

1. $10 + 130 =$ _____

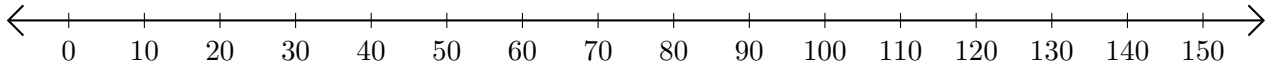

2. $120 - 100 =$ ____

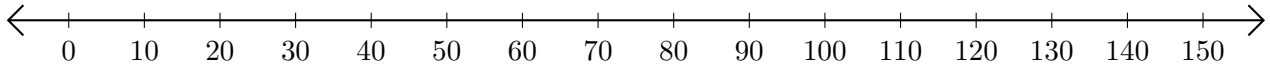

3. $50 + 60 =$ _____

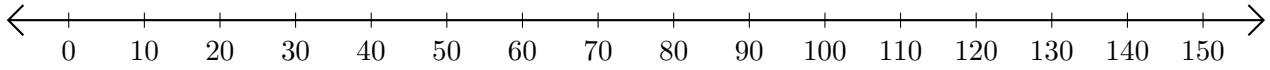

4. $30 - 20 =$ ____

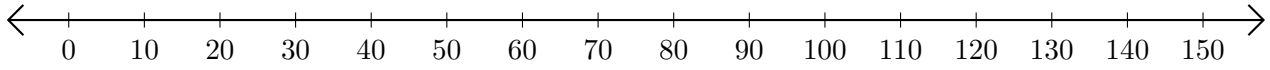
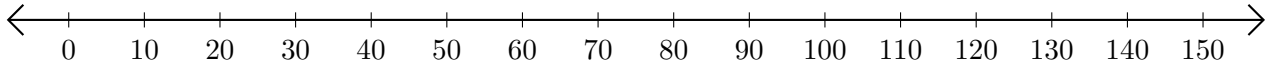
5. $140 - 70 =$ ____