# Opérations sur Une Droite Graduée (H)

Utlisez la droite graduée pour calculer chaque somme ou différence.

1. $10 + 130 =$ _____

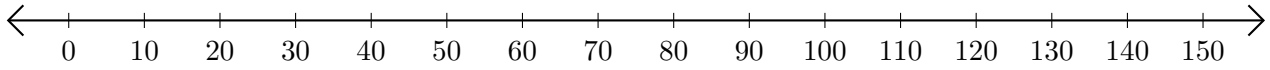


2. $120 - 100 =$ ____

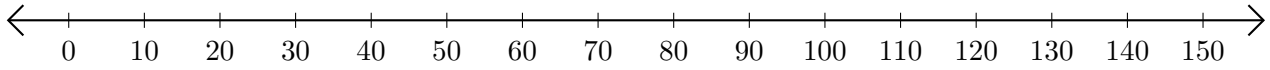


3. $50 + 60 =$ _____

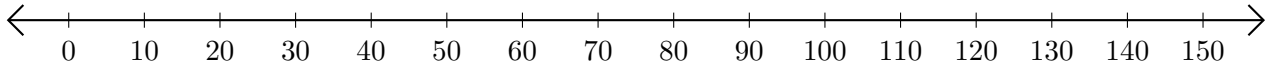


4. $30 - 20 =$ ____

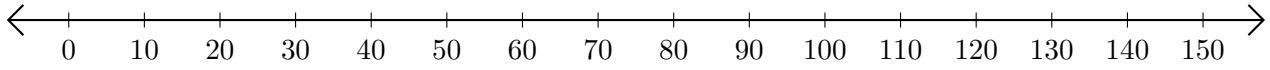


5. $140 - 70 =$ ____

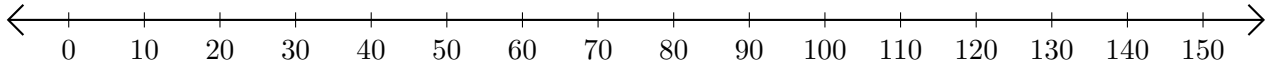

# Opérations sur Une Droite Graduée (H) Réponses

Utlisez la droite graduée pour calculer chaque somme ou différence.

1. $10 + 130 =$ 140

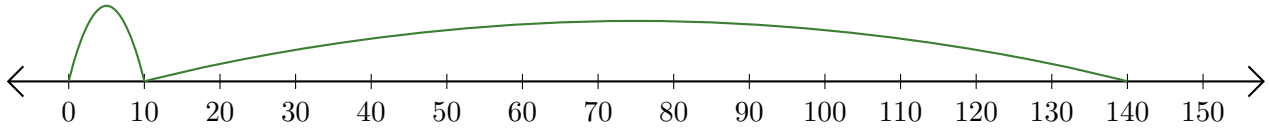


2. $120 - 100 =$ 20

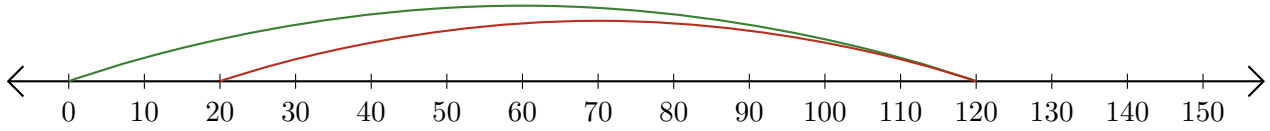


3. $50 + 60 =$ 110

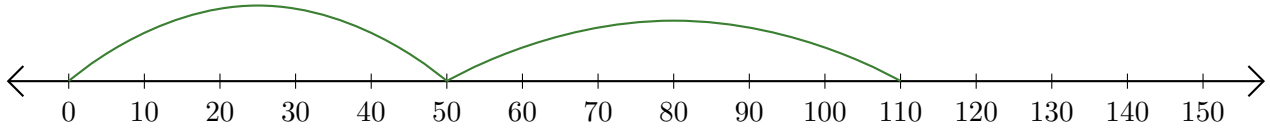


4. $30 - 20 =$ 10

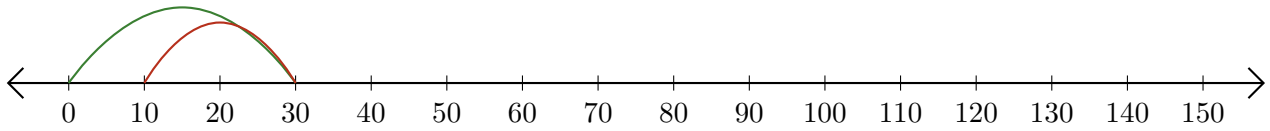

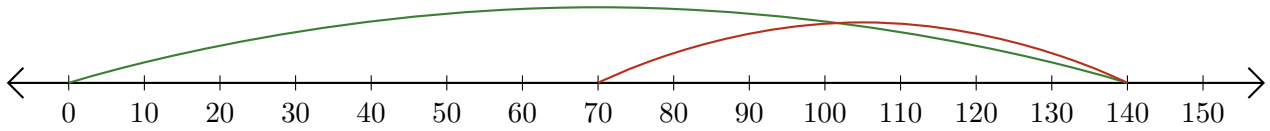
5. $140 - 70 =$ 70