Opérations sur Une Droite Graduée (J)

Utlisez la droite graduée pour calculer chaque somme ou différence.

1. $10 + 80 =$ ____

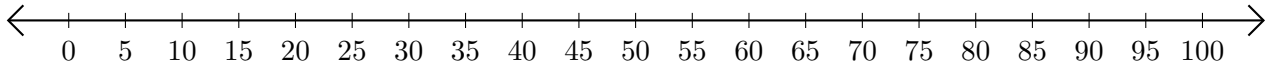

2. $100 - 85 =$ ____

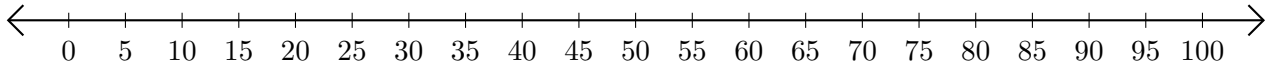

3. $5 + 65 =$ ____

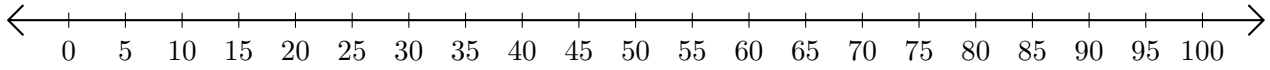

4. $100 - 95 =$ ___

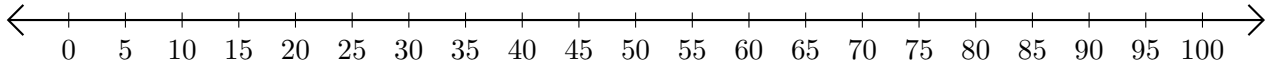
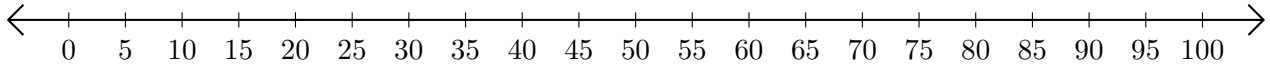
5. $95 - 90 =$ ___