Opérations sur Une Droite Graduée (H)

Utlisez la droite graduée pour calculer chaque somme ou différence.

1. $5 + 75 =$ ____

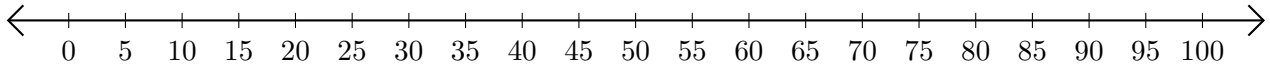

2. $95 - 50 =$ ____

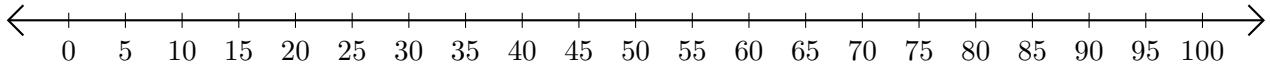

3. $15 + 50 =$ ____

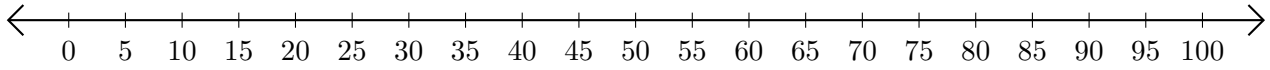

4. $100 - 60 =$ ____

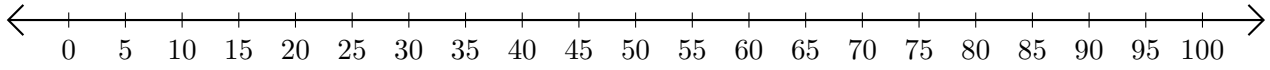
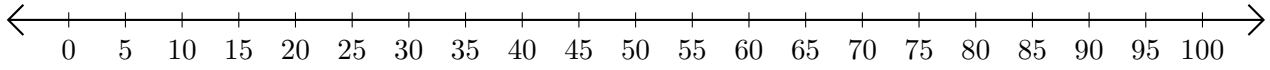
5. $10 + 50 =$ ____