Opérations sur Une Droite Graduée (H)

Utlisez la droite graduée pour calculer chaque somme ou différence.

1. $5 + 75 =$ ____

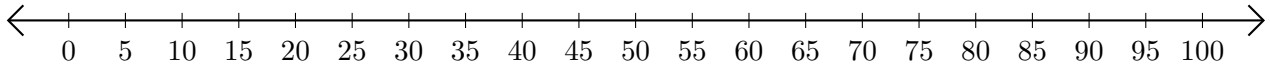

2. $95 - 50 =$ ____

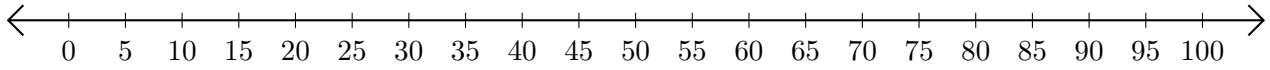

3. $15 + 50 =$ ____

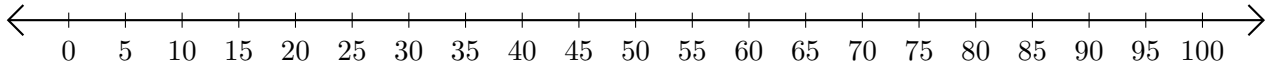

4. $100 - 60 =$ ____

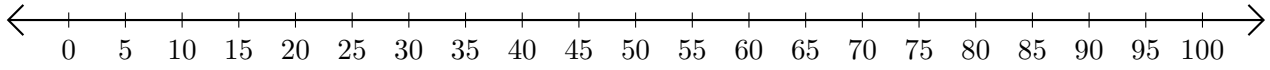

5. $10 + 50 =$ ____

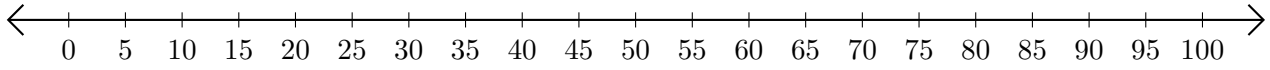

Opérations sur Une Droite Graduée (H) Réponses

Utlisez la droite graduée pour calculer chaque somme ou différence.

1. $5 + 75 =$ 80

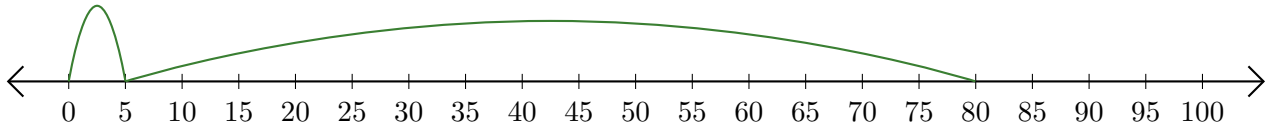

2. $95 - 50 =$ 45

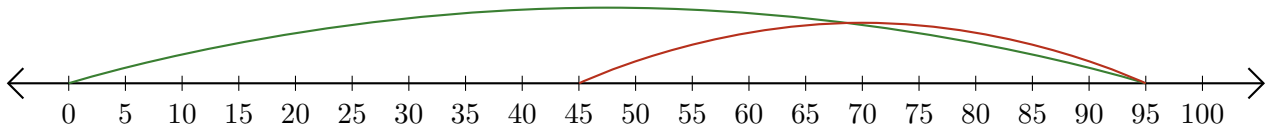

3. $15 + 50 =$ 65

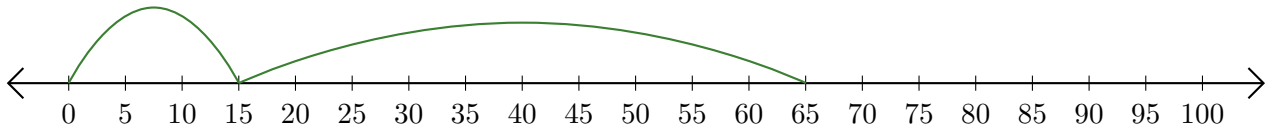

4. $100 - 60 =$ 40

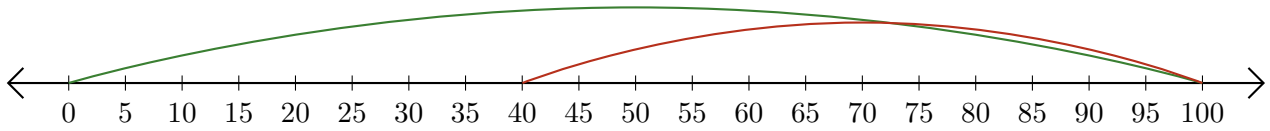
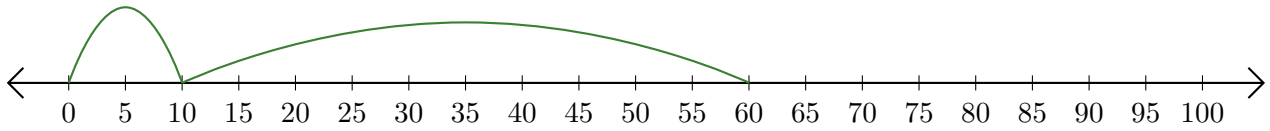
5. $10 + 50 =$ 60