Opérations sur Une Droite Graduée (G)

Utlisez la droite graduée pour calculer chaque somme ou différence.

1. $75 + 25 =$ _____

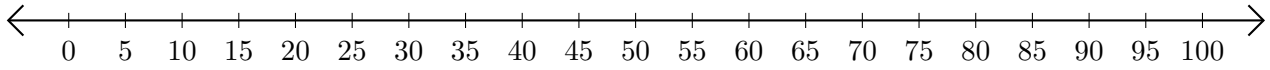

2. $15 - 5 =$ ____

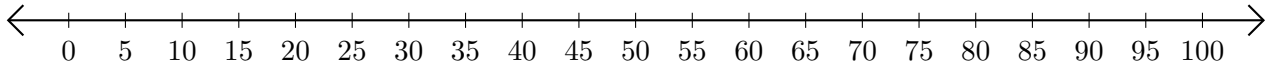

3. $15 + 50 =$ ____

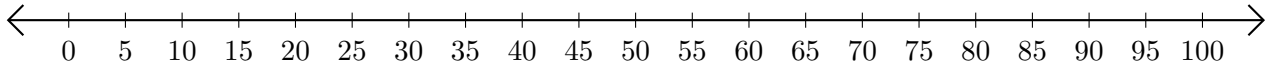

4. $80 - 55 =$ ____

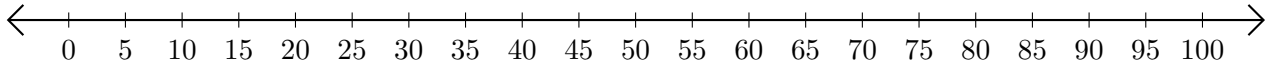

5. $100 - 95 =$ ___

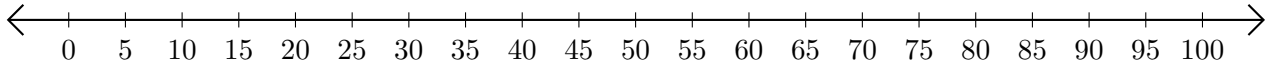

Opérations sur Une Droite Graduée (G) Réponses

Utlisez la droite graduée pour calculer chaque somme ou différence.

1. $75 + 25 =$ 100

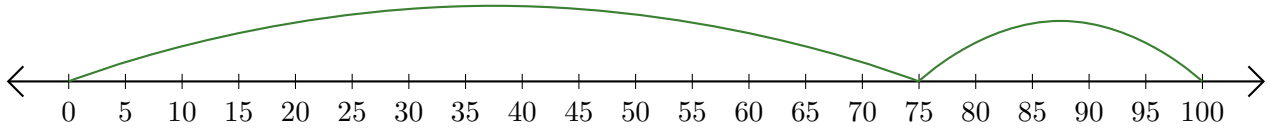

2. $15 - 5 =$ 10



3. $15 + 50 =$ 65

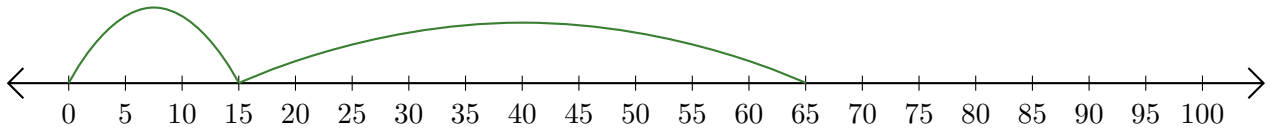

4. $80 - 55 =$ 25

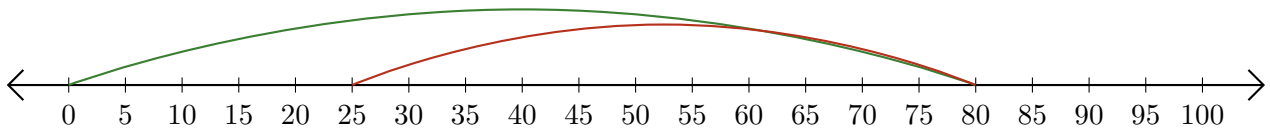
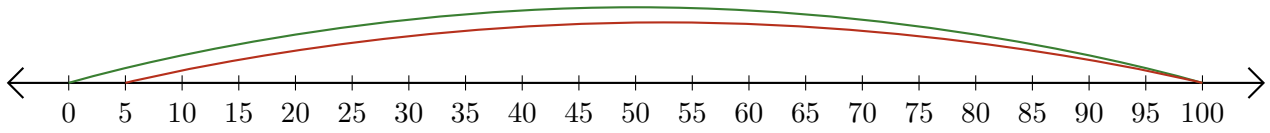
5. $100 - 95 =$ 5