Opérations sur Une Droite Graduée (D)

Utlisez la droite graduée pour calculer chaque somme ou différence.

1. $45 + 10 =$ ____

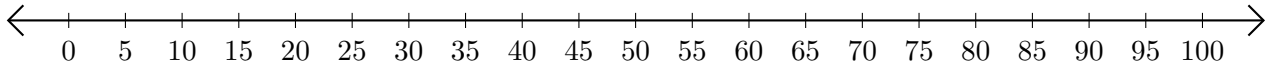

2. $100 - 75 =$ ____

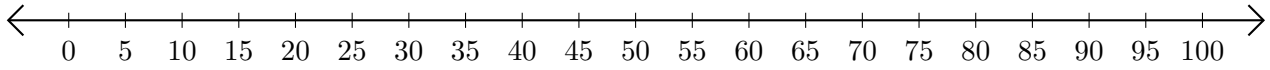

3. $10 + 55 =$ ____

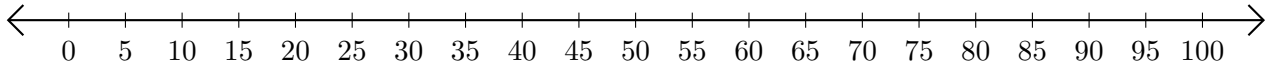

4. $95 - 55 =$ ____

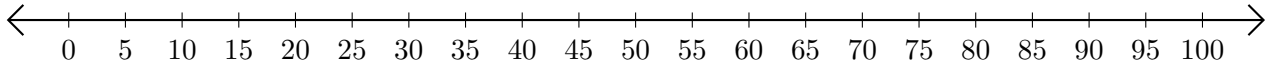
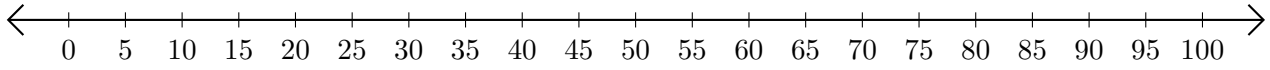
5. $60 + 40 =$ _____